Edexcel Maths Core 1

Past Paper Pack

2005-2014

PhysicsAndMathsTutor.com

physicsandmathstutor.com

Centre No.						Paper Reference							Surname	Initial(s)
Candidate No.						6	6	6	3	/	0	1	Signature	

Paper Reference(s)

6663/01

Edexcel GCE

Core Mathematics C1

Advanced Subsidiary

Monday 23 May 2005 – Morning

Time: 1 hour 30 minutes

Examiner's use only

Team Leader's use only

Question Number	Leave Blank
1	
2	
3	
4	
5	
6	
7	
8	
9	
10	
Total	

Materials required for examination
Mathematical Formulae (Green)

Items included with question papers
Nil

Calculators may NOT be used in this examination.

Instructions to Candidates

In the boxes above, write your centre number, candidate number, your surname, initials and signature.
Check that you have the correct question paper.
You must write your answer for each question in the space following the question.

Information for Candidates

A booklet 'Mathematical Formulae and Statistical Tables' is provided.
Full marks may be obtained for answers to ALL questions.
The marks for individual questions and the parts of questions are shown in round brackets: e.g. **(2)**.
There are 10 questions in this question paper. The total mark for this paper is 75.
There are 24 pages in this question paper. Any blank pages are indicated.

Advice to Candidates

You must ensure that your answers to parts of questions are clearly labelled.
You must show sufficient working to make your methods clear to the Examiner. Answers without working may gain no credit.

This publication may be reproduced only in accordance with Edexcel Limited copyright policy.
©2005 Edexcel Limited.

Printer's Log. No.
N23491C
W850/R6663/57570 7/7/3/3/3/2/2/3

N 2 3 4 9 1 C 0 1 2 4

Turn over

edexcel

Leave blank

1. (a) Write down the value of $8^{\frac{1}{3}}$.

(1)

(b) Find the value of $8^{-\frac{2}{3}}$.

(2)

Q1

(Total 3 marks)

Leave blank

2. Given that $y = 6x - \frac{4}{x^2}$, $x \neq 0$,

(a) find $\frac{dy}{dx}$,

(2)

(b) find $\int y \, dx$.

(3)

N 2 3 4 9 1 C 0 4 2 4

Leave blank

3. $$x^2 - 8x - 29 \equiv (x + a)^2 + b,$$

where a and b are constants.

(a) Find the value of a and the value of b.

(3)

(b) Hence, or otherwise, show that the roots of

$$x^2 - 8x - 29 = 0$$

are $c \pm d\sqrt{5}$, where c and d are integers to be found.

(3)

Leave blank

4. **Figure 1**

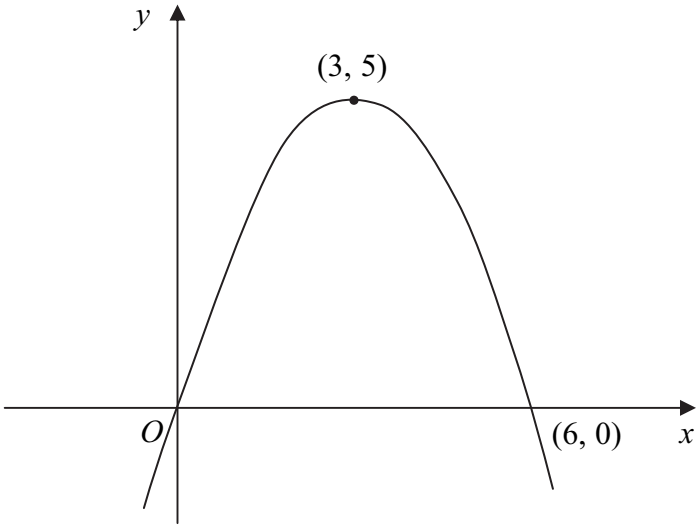

Figure 1 shows a sketch of the curve with equation $y = \mathrm{f}(x)$. The curve passes through the origin O and through the point (6, 0). The maximum point on the curve is (3, 5).

On separate diagrams, sketch the curve with equation

(a) $y = 3\mathrm{f}(x)$,

(2)

(b) $y = \mathrm{f}(x + 2)$.

(3)

On each diagram, show clearly the coordinates of the maximum point and of each point at which the curve crosses the x-axis.

N 2 3 4 9 1 C 0 8 2 4

Leave blank

5. Solve the simultaneous equations

$$x - 2y = 1,$$

$$x^2 + y^2 = 29.$$

(6)

N 2 3 4 9 1 C 0 1 0 2 4

Leave blank

6. Find the set of values of x for which

(a) $3(2x + 1) > 5 - 2x$,

(2)

(b) $2x^2 - 7x + 3 > 0$,

(4)

(c) **both** $3(2x + 1) > 5 - 2x$ **and** $2x^2 - 7x + 3 > 0$.

(2)

Leave blank

7. (a) Show that $\dfrac{(3-\sqrt{x})^2}{\sqrt{x}}$ can be written as $9x^{-\frac{1}{2}} - 6 + x^{\frac{1}{2}}$.

(2)

Given that $\dfrac{dy}{dx} = \dfrac{(3-\sqrt{x})^2}{\sqrt{x}}$, $x > 0$, and that $y = \frac{2}{3}$ at $x = 1$,

(b) find y in terms of x.

(6)

N 2 3 4 9 1 C 0 1 4 2 4

Leave blank

8. The line l_1 passes through the point (9, –4) and has gradient $\frac{1}{3}$.

(a) Find an equation for l_1 in the form $ax + by + c = 0$, where a, b and c are integers.

(3)

The line l_2 passes through the origin O and has gradient –2. The lines l_1 and l_2 intersect at the point P.

(b) Calculate the coordinates of P.

(4)

Given that l_1 crosses the y-axis at the point C,

(c) calculate the exact area of $\triangle OCP$.

(3)

Leave blank

Question 8 continued

Q8

(Total 10 marks)

Leave blank

9. An arithmetic series has first term a and common difference d.

(a) Prove that the sum of the first n terms of the series is

$$\tfrac{1}{2}n[2a+(n-1)d].$$

(4)

Sean repays a loan over a period of n months. His monthly repayments form an arithmetic sequence.

He repays £149 in the first month, £147 in the second month, £145 in the third month, and so on. He makes his final repayment in the nth month, where $n > 21$.

(b) Find the amount Sean repays in the 21st month.

(2)

Over the n months, he repays a total of £5000.

(c) Form an equation in n, and show that your equation may be written as

$$n^2 - 150n + 5000 = 0.$$

(3)

(d) Solve the equation in part (c).

(3)

(e) State, with a reason, which of the solutions to the equation in part (c) is **not** a sensible solution to the repayment problem.

(1)

Leave blank

Question 9 continued

Leave blank

10. The curve C has equation $y = \frac{1}{3}x^3 - 4x^2 + 8x + 3$.

The point P has coordinates (3, 0).

(a) Show that P lies on C.

(1)

(b) Find the equation of the tangent to C at P, giving your answer in the form $y = mx + c$, where m and c are constants.

(5)

Another point Q also lies on C. The tangent to C at Q is parallel to the tangent to C at P.

(c) Find the coordinates of Q.

(5)

Leave blank

Question 10 continued

Q10

(Total 11 marks)

TOTAL FOR PAPER: 75 MARKS

END

physicsandmathstutor.com

Centre No.						Paper Reference							Surname	Initial(s)
Candidate No.						6	6	6	3	/	0	1	Signature	

Paper Reference(s)

6663/01

Edexcel GCE

Core Mathematics C1

Advanced Subsidiary

Tuesday 10 January 2006 – Afternoon

Time: 1 hour 30 minutes

Materials required for examination
Mathematical Formulae (Green)

Items included with question papers
Nil

Calculators may NOT be used in this examination.

Examiner's use only

Team Leader's use only

Question Number	Leave Blank
1	
2	
3	
4	
5	
6	
7	
8	
9	
10	
Total	

Instructions to Candidates

In the boxes above, write your centre number, candidate number, your surname, initial(s) and signature.
Check that you have the correct question paper.
You must write your answer for each question in the space following the question.

Information for Candidates

A booklet 'Mathematical Formulae and Statistical Tables' is provided.
Full marks may be obtained for answers to ALL questions.
The marks for individual questions and the parts of questions are shown in round brackets: e.g. **(2)**.
There are 10 questions in this question paper. The total mark for this paper is 75.
There are 20 pages in this question paper. Any blank pages are indicated.

Advice to Candidates

You must ensure that your answers to parts of questions are clearly labelled.
You must show sufficient working to make your methods clear to the Examiner. Answers without working may gain no credit.

This publication may be reproduced only in accordance with Edexcel Limited copyright policy.
©2006 Edexcel Limited.

Printer's Log. No.
N20233A
W850/R6663/57570 7/3/3/3/3/45,000

N 2 0 2 3 3 A 0 1 2 0

Turn over

edexcel

Leave blank

1. Factorise completely

$$x^3 - 4x^2 + 3x.$$

(3)

Q1

(Total 3 marks)

Leave blank

2. The sequence of positive numbers u_1, u_2, u_3, ... is given by:

$$u_{n+1} = (u_n - 3)^2, \qquad u_1 = 1.$$

(a) Find u_2, u_3 and u_4.

(3)

(b) Write down the value of u_{20}.

(1)

Q2

(Total 4 marks)

Leave blank

3. The line L has equation $y = 5 - 2x$.

(a) Show that the point P (3, –1) lies on L.

(1)

(b) Find an equation of the line perpendicular to L, which passes through P. Give your answer in the form $ax + by + c = 0$, where a, b and c are integers.

(4)

Q3

(Total 5 marks)

Leave blank

4. Given that $y = 2x^2 - \frac{6}{x^3}$, $x \neq 0$,

(a) find $\frac{dy}{dx}$,

(2)

(b) find $\int y \, dx$.

(3)

Q4

(Total 5 marks)

Leave blank

5. (a) Write $\sqrt{45}$ in the form $a\sqrt{5}$, where a is an integer.

(1)

(b) Express $\dfrac{2(3+\sqrt{5})}{(3-\sqrt{5})}$ in the form $b + c\sqrt{5}$, where b and c are integers.

(5)

Leave blank

6. **Figure 1**

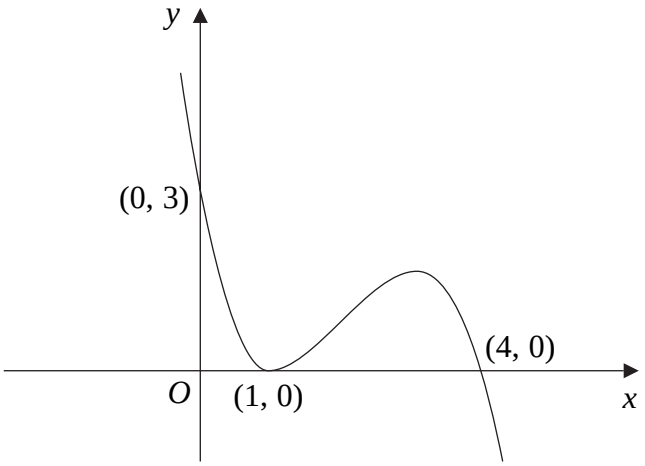

Figure 1 shows a sketch of the curve with equation $y = \mathrm{f}(x)$. The curve passes through the points (0, 3) and (4, 0) and touches the x-axis at the point (1, 0).

On separate diagrams sketch the curve with equation

(a) $y = \mathrm{f}(x + 1)$,

(3)

(b) $y = 2\,\mathrm{f}(x)$,

(3)

(c) $y = \mathrm{f}\left(\frac{1}{2}x\right)$.

(3)

On each diagram show clearly the coordinates of all the points where the curve meets the axes.

N 2 0 2 3 3 A 0 8 2 0

Leave blank

Question 6 continued

Q6

(Total 9 marks)

Leave blank

7. On Alice's 11th birthday she started to receive an annual allowance. The first annual allowance was £500 and on each following birthday the allowance was increased by £200.

(a) Show that, immediately after her 12th birthday, the total of the allowances that Alice had received was £1200.

(1)

(b) Find the amount of Alice's annual allowance on her 18th birthday.

(2)

(c) Find the total of the allowances that Alice had received up to and including her 18th birthday.

(3)

When the total of the allowances that Alice had received reached £32 000 the allowance stopped.

(d) Find how old Alice was when she received her last allowance.

(7)

Leave blank

Question 7 continued

(Total 13 marks)

Q7

Leave blank

8. The curve with equation $y = \mathrm{f}(x)$ passes through the point (1, 6). Given that

$$\mathrm{f}'(x) = 3 + \frac{5x^2 + 2}{x^{\frac{1}{2}}}, \quad x > 0,$$

find $\mathrm{f}(x)$ and simplify your answer.

(7)

Leave blank

9. **Figure 2**

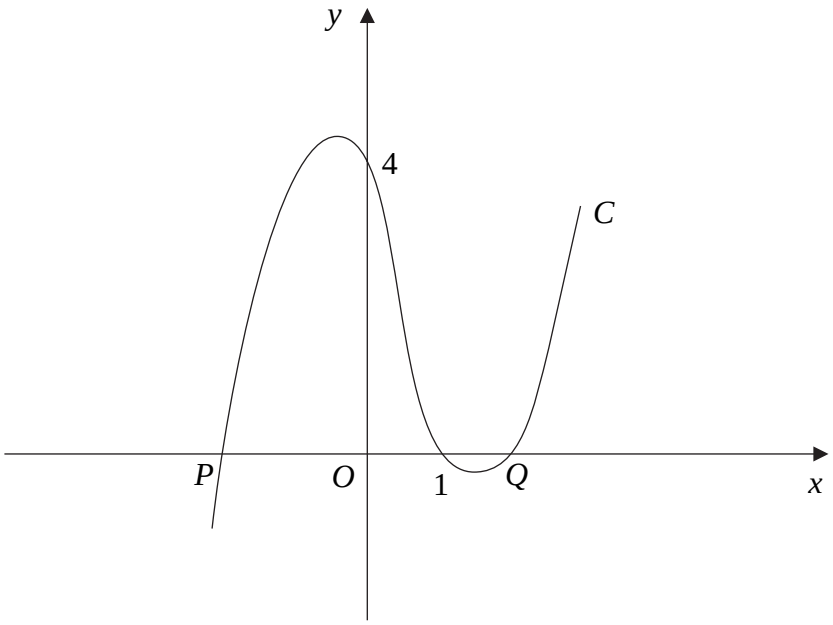

Figure 2 shows part of the curve C with equation

$$y = (x - 1)(x^2 - 4).$$

The curve cuts the x-axis at the points P, (1, 0) and Q, as shown in Figure 2.

(a) Write down the x-coordinate of P, and the x-coordinate of Q.

(2)

(b) Show that $\frac{dy}{dx} = 3x^2 - 2x - 4$.

(3)

(c) Show that $y = x + 7$ is an equation of the tangent to C at the point (–1, 6).

(2)

The tangent to C at the point R is parallel to the tangent at the point (–1, 6).

(d) Find the exact coordinates of R.

(5)

N 2 0 2 3 3 A 0 1 4 2 0

Leave blank

Question 9 continued

(Total 12 marks)

Q9

Leave blank

10. $$x^2 + 2x + 3 \equiv (x + a)^2 + b.$$

(a) Find the values of the constants a and b.

(2)

(b) In the space provided below, sketch the graph of $y = x^2 + 2x + 3$, indicating clearly the coordinates of any intersections with the coordinate axes.

(3)

(c) Find the value of the discriminant of $x^2 + 2x + 3$. Explain how the sign of the discriminant relates to your sketch in part (b).

(2)

The equation $x^2 + kx + 3 = 0$, where k is a constant, has no real roots.

(d) Find the set of possible values of k, giving your answer in surd form.

(4)

Leave blank

Question 10 continued

Q10

(Total 11 marks)

TOTAL FOR PAPER: 75 MARKS

END

N 2 0 2 3 3 A 0 2 0 2 0

physicsandmathstutor.com

Centre No.						Paper Reference							Surname	Initial(s)
Candidate No.						6	6	6	3	/	0	1	Signature	

Paper Reference(s)

6663/01

Edexcel GCE

Core Mathematics C1

Advanced Subsidiary

Monday 22 May 2006 – Morning

Time: 1 hour 30 minutes

Examiner's use only

Team Leader's use only

Question Number	Leave Blank
1	
2	
3	
4	
5	
6	
7	
8	
9	
10	
11	
Total	

Materials required for examination
Mathematical Formulae (Green)

Items included with question papers
Nil

Calculators may NOT be used in this examination.

Instructions to Candidates

In the boxes above, write your centre number, candidate number, your surname, initial(s) and signature.
Check that you have the correct question paper.
You must write your answer for each question in the space following the question.

Information for Candidates

A booklet 'Mathematical Formulae and Statistical Tables' is provided.
Full marks may be obtained for answers to ALL questions.
The marks for individual questions and the parts of questions are shown in round brackets: e.g. **(2)**.
There are 11 questions in this question paper. The total mark for this paper is 75.
There are 24 pages in this question paper. Any blank pages are indicated.

Advice to Candidates

You must ensure that your answers to parts of questions are clearly labelled.
You must show sufficient working to make your methods clear to the examiner. Answers without working may gain no credit.

This publication may be reproduced only in accordance with Edexcel Limited copyright policy.
©2006 Edexcel Limited.

Printer's Log. No.
N23557A
W850/R6663/57570 3/3/3/3/3/53,900

N 2 3 5 5 7 A 0 1 2 4

Turn over

edexcel

Leave blank

1. Find $\int \left(6x^2 + 2 + x^{-\frac{1}{2}}\right) \mathrm{d}x$, giving each term in its simplest form.

(4)

Q1

(Total 4 marks)

N 2 3 5 5 7 A 0 2 2 4

Leave blank

2. Find the set of values of x for which

$$x^2 - 7x - 18 > 0.$$

(4)

Q2

(Total 4 marks)

Leave blank

3. On separate diagrams, sketch the graphs of

(a) $y = (x + 3)^2$,

(3)

(b) $y = (x + 3)^2 + k$, where k is a positive constant.

(2)

Show on each sketch the coordinates of each point at which the graph meets the axes.

Leave blank

4. A sequence $a_1, a_2, a_3, \ldots$ is defined by

$$a_1 = 3,$$
$$a_{n+1} = 3a_n - 5, \quad n \geqslant 1.$$

(a) Find the value of a_2 and the value of a_3.

(2)

(b) Calculate the value of $\sum_{r=1}^{5} a_r$.

(3)

N 2 3 5 5 7 A 0 6 2 4

Leave blank

5. Differentiate with respect to x

(a) $x^4 + 6\sqrt{x}$,

(3)

(b) $\dfrac{(x+4)^2}{x}$.

(4)

N 2 3 5 5 7 A 0 8 2 4

Leave blank

6. (a) Expand and simplify $(4 + \sqrt{3})(4 - \sqrt{3})$.

(2)

(b) Express $\dfrac{26}{4+\sqrt{3}}$ in the form $a + b\sqrt{3}$, where a and b are integers.

(2)

N 2 3 5 5 7 A 0 1 0 2 4

Leave blank

7. An athlete prepares for a race by completing a practice run on each of 11 consecutive days. On each day after the first day, he runs further than he ran on the previous day. The lengths of his 11 practice runs form an arithmetic sequence with first term a km and common difference d km.

He runs 9 km on the 11th day, and he runs a total of 77 km over the 11 day period.

Find the value of a and the value of d.

(7)

Leave blank

8. The equation $x^2 + 2px + (3p + 4) = 0$, where p is a positive constant, has equal roots.

(a) Find the value of p.

(4)

(b) For this value of p, solve the equation $x^2 + 2px + (3p + 4) = 0$.

(2)

Leave blank

9. Given that $f(x) = (x^2 - 6x)(x - 2) + 3x$,

(a) express $f(x)$ in the form $x(ax^2 + bx + c)$, where a, b and c are constants.

(3)

(b) Hence factorise $f(x)$ completely.

(2)

(c) Sketch the graph of $y = f(x)$, showing the coordinates of each point at which the graph meets the axes.

(3)

Leave blank

10. The curve C with equation $y = \mathrm{f}(x)$, $x \neq 0$, passes through the point $(3, 7\frac{1}{2})$.

Given that $\mathrm{f}'(x) = 2x + \dfrac{3}{x^2}$,

(a) find $\mathrm{f}(x)$.

(5)

(b) Verify that $\mathrm{f}(-2) = 5$.

(1)

(c) Find an equation for the tangent to C at the point $(-2, 5)$, giving your answer in the form $ax + by + c = 0$, where a, b and c are integers.

(4)

N 2 3 5 5 7 A 0 1 8 2 4

Leave blank

Question 10 continued

Q10

(Total 10 marks)

Leave blank

11. The line l_1 passes through the points $P(-1, 2)$ and $Q(11, 8)$.

(a) Find an equation for l_1 in the form $y = mx + c$, where m and c are constants.

(4)

The line l_2 passes through the point $R(10, 0)$ and is perpendicular to l_1. The lines l_1 and l_2 intersect at the point S.

(b) Calculate the coordinates of S.

(5)

(c) Show that the length of RS is $3\sqrt{5}$.

(2)

(d) Hence, or otherwise, find the exact area of triangle PQR.

(4)

Leave blank

Question 11 continued

Q11

(Total 15 marks)

TOTAL FOR PAPER: 75 MARKS

END

N 2 3 5 5 7 A 0 2 3 2 4

physicsandmathstutor.com

Centre No.						Paper Reference							Surname	Initial(s)
Candidate No.						6	6	6	3	/	0	1	Signature	

Paper Reference(s)

6663/01

Edexcel GCE

Core Mathematics C1

Advanced Subsidiary

Wednesday 10 January 2007 – Afternoon

Time: 1 hour 30 minutes

Materials required for examination	Items included with question papers
Mathematical Formulae (Green)	Nil

Calculators may NOT be used in this examination.

Examiner's use only

Team Leader's use only

Question Number	Leave Blank
1	
2	
3	
4	
5	
6	
7	
8	
9	
10	
Total	

Instructions to Candidates

In the boxes above, write your centre number, candidate number, your surname, initial(s) and signature.
Check that you have the correct question paper.
You must write your answer for each question in the space following the question.

Information for Candidates

A booklet 'Mathematical Formulae and Statistical Tables' is provided.
Full marks may be obtained for answers to ALL questions.
The marks for individual questions and the parts of questions are shown in round brackets: e.g. **(2)**.
There are 10 questions in this question paper. The total mark for this question paper is 75.
There are 20 pages in this question paper. Any blank pages are indicated.

Advice to Candidates

You must ensure that your answers to parts of questions are clearly labelled.
You must show sufficient working to make your methods clear to the Examiner. Answers without working may gain no credit.

This publication may be reproduced only in accordance with Edexcel Limited copyright policy.
©2007 Edexcel Limited.

Printer's Log. No.
N23561A
W850/R6663/57570 3/3/3/3/3/38,600

N 2 3 5 6 1 A 0 1 2 0

Turn over

edexcel
advancing learning, changing lives

Leave blank

1. Given that

$$y = 4x^3 - 1 + 2x^{\frac{1}{2}}, \quad x > 0,$$

find $\frac{dy}{dx}$.

(4)

Q1

(Total 4 marks)

Leave blank

2. (a) Express $\sqrt{108}$ in the form $a\sqrt{3}$, where a is an integer.

(1)

(b) Express $(2 - \sqrt{3})^2$ in the form $b + c\sqrt{3}$, where b and c are integers to be found.

(3)

Q2

(Total 4 marks)

Leave blank

3. Given that $$f(x) = \frac{1}{x}, \quad x \neq 0,$$

(a) sketch the graph of $y = f(x) + 3$ and state the equations of the asymptotes.

(4)

(b) Find the coordinates of the point where $y = f(x) + 3$ crosses a coordinate axis.

(2)

Leave blank

4. Solve the simultaneous equations

$$y = x - 2,$$

$$y^2 + x^2 = 10.$$

(7)

N 2 3 5 6 1 A 0 6 2 0

Leave blank

5. The equation $2x^2 - 3x - (k + 1) = 0$, where k is a constant, has no real roots.

Find the set of possible values of k.

(4)

Q5

(Total 4 marks)

N 2 3 5 6 1 A 0 8 2 0

Leave blank

6. (a) Show that $(4 + 3\sqrt{x})^2$ can be written as $16 + k\sqrt{x} + 9x$, where k is a constant to be found.

(2)

(b) Find $\int (4 + 3\sqrt{x})^2 \, dx$.

(3)

Q6

(Total 5 marks)

Leave blank

7. The curve C has equation $y = \mathrm{f}(x)$, $x \neq 0$, and the point P (2, 1) lies on C. Given that

$$\mathrm{f}'(x) = 3x^2 - 6 - \frac{8}{x^2},$$

(a) find $\mathrm{f}(x)$.

(5)

(b) Find an equation for the tangent to C at the point P, giving your answer in the form $y = mx + c$, where m and c are integers.

(4)

Leave blank

8. The curve C has equation $y = 4x + 3x^{\frac{3}{2}} - 2x^2, \quad x > 0$.

(a) Find an expression for $\frac{dy}{dx}$.

(3)

(b) Show that the point P (4, 8) lies on C.

(1)

(c) Show that an equation of the normal to C at the point P is

$$3y = x + 20.$$

(4)

The normal to C at P cuts the x-axis at the point Q.

(d) Find the length PQ, giving your answer in a simplified surd form.

(3)

Leave blank

Question 8 continued

Q8

(Total 11 marks)

Leave blank

9. Ann has some sticks that are all of the same length. She arranges them in squares and has made the following 3 rows of patterns:

Row 1

Row 2

Row 3

She notices that 4 sticks are required to make the single square in the first row, 7 sticks to make 2 squares in the second row and in the third row she needs 10 sticks to make 3 squares.

(a) Find an expression, in terms of n, for the number of sticks required to make a similar arrangement of n squares in the nth row.

(3)

Ann continues to make squares following the same pattern. She makes 4 squares in the 4th row and so on until she has completed 10 rows.

(b) Find the total number of sticks Ann uses in making these 10 rows.

(3)

Ann started with 1750 sticks. Given that Ann continues the pattern to complete k rows but does not have sufficient sticks to complete the $(k + 1)$th row,

(c) show that k satisfies $(3k - 100)(k + 35) < 0$.

(4)

(d) Find the value of k.

(2)

N 2 3 5 6 1 A 0 1 4 2 0

Leave blank

Question 9 continued

Q9

(Total 12 marks)

Leave blank

10. (a) On the same axes sketch the graphs of the curves with equations

(i) $y = x^2(x - 2)$,

(3)

(ii) $y = x(6 - x)$,

(3)

and indicate on your sketches the coordinates of all the points where the curves cross the x-axis.

(b) Use algebra to find the coordinates of the points where the graphs intersect.

(7)

Leave blank

Question 10 continued

Q10

(Total 13 marks)

TOTAL FOR PAPER: 75 MARKS

END

N 2 3 5 6 1 A 0 2 0 2 0

physicsandmathstutor.com

Centre No.						Paper Reference							Surname	Initial(s)
Candidate No.						6	6	6	3	/	0	1	Signature	

Paper Reference(s)

6663/01

Edexcel GCE

Core Mathematics C1

Advanced Subsidiary

Monday 21 May 2007 – Morning

Time: 1 hour 30 minutes

Examiner's use only

Team Leader's use only

Question Number	Leave Blank
1	
2	
3	
4	
5	
6	
7	
8	
9	
10	
11	
Total	

Materials required for examination
Mathematical Formulae (Green)

Items included with question papers
Nil

Calculators may NOT be used in this examination.

Instructions to Candidates

In the boxes above, write your centre number, candidate number, your surname, initials and signature.
Check that you have the correct question paper.
You must write your answer for each question in the space following the question.

Information for Candidates

A booklet 'Mathematical Formulae and Statistical Tables' is provided.
Full marks may be obtained for answers to ALL questions.
The marks for individual questions and the parts of questions are shown in round brackets: e.g. **(2)**.
There are 11 questions in this question paper. The total mark for this paper is 75.
There are 24 pages in this question paper. Any blank pages are indicated.

Advice to Candidates

You must ensure that your answers to parts of questions are clearly labelled.
You should show sufficient working to make your methods clear to the Examiner.
Answers without working may not gain full credit.

This publication may be reproduced only in accordance with Edexcel Limited copyright policy.
©2007 Edexcel Limited.

Printer's Log. No.
H26107A
W850/R6663/57570 3/3/3/3/3/

H 2 6 1 0 7 A 0 1 2 4

Turn over

edexcel
advancing learning, changing lives

Leave blank

1. Simplify $(3+\sqrt{5})(3-\sqrt{5})$.

(2)

Q1

(Total 2 marks)

Leave blank

2. (a) Find the value of $8^{\frac{4}{3}}$.

(2)

(b) Simplify $\dfrac{15x^{\frac{4}{3}}}{3x}$.

(2)

Q2

(Total 4 marks)

Leave blank

3. Given that $y = 3x^2 + 4\sqrt{x}, \quad x > 0$, find

(a) $\dfrac{dy}{dx}$, **(2)**

(b) $\dfrac{d^2y}{dx^2}$, **(2)**

(c) $\int y \, dx$. **(3)**

Leave blank

4. A girl saves money over a period of 200 weeks. She saves 5p in Week 1, 7p in Week 2, 9p in Week 3, and so on until Week 200. Her weekly savings form an arithmetic sequence.

(a) Find the amount she saves in Week 200.

(3)

(b) Calculate her total savings over the complete 200 week period.

(3)

Leave blank

5.

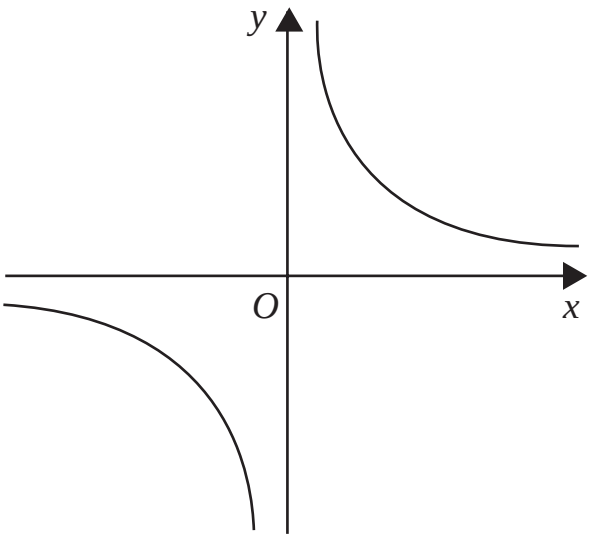

Figure 1

Figure 1 shows a sketch of the curve with equation $y = \frac{3}{x}$, $x \neq 0$.

(a) On a separate diagram, sketch the curve with equation $y = \frac{3}{x+2}$, $x \neq -2$, showing the coordinates of any point at which the curve crosses a coordinate axis.

(3)

(b) Write down the equations of the asymptotes of the curve in part (a).

(2)

Leave blank

6. (a) By eliminating y from the equations

$$y = x - 4,$$

$$2x^2 - xy = 8,$$

show that

$$x^2 + 4x - 8 = 0.$$

(2)

(b) Hence, or otherwise, solve the simultaneous equations

$$y = x - 4,$$

$$2x^2 - xy = 8,$$

giving your answers in the form $a \pm b\sqrt{3}$, where a and b are integers.

(5)

Leave blank

7. The equation $x^2 + kx + (k+3) = 0$, where k is a constant, has different real roots.

(a) Show that $k^2 - 4k - 12 > 0$.

(2)

(b) Find the set of possible values of k.

(4)

Leave blank

8. A sequence $a_1, a_2, a_3, \ldots$ is defined by

$$a_1 = k,$$

$$a_{n+1} = 3a_n + 5, \qquad n \geqslant 1,$$

where k is a positive integer.

(a) Write down an expression for a_2 in terms of k.

(1)

(b) Show that $a_3 = 9k + 20$.

(2)

(c) (i) Find $\sum_{r=1}^{4} a_r$ in terms of k.

(ii) Show that $\sum_{r=1}^{4} a_r$ is divisible by 10.

(4)

H 2 6 1 0 7 A 0 1 4 2 4

Leave blank

9. The curve C with equation $y = \mathrm{f}(x)$ passes through the point (5, 65).

Given that $\mathrm{f}'(x) = 6x^2 - 10x - 12$,

(a) use integration to find $\mathrm{f}(x)$.

(4)

(b) Hence show that $\mathrm{f}(x) = x(2x+3)(x-4)$.

(2)

(c) In the space provided on page 17, sketch C, showing the coordinates of the points where C crosses the x-axis.

(3)

Leave blank

Question 9 continued

Q9

(Total 9 marks)

Leave blank

10. The curve C has equation $y = x^2(x-6) + \frac{4}{x}$, $x > 0$.

The points P and Q lie on C and have x-coordinates 1 and 2 respectively.

(a) Show that the length of PQ is $\sqrt{170}$.

(4)

(b) Show that the tangents to C at P and Q are parallel.

(5)

(c) Find an equation for the normal to C at P, giving your answer in the form $ax + by + c = 0$, where a, b and c are integers.

(4)

Leave blank

Question 10 continued

Leave blank

11. The line l_1 has equation $y = 3x + 2$ and the line l_2 has equation $3x + 2y - 8 = 0$.

(a) Find the gradient of the line l_2.

(2)

The point of intersection of l_1 and l_2 is P.

(b) Find the coordinates of P.

(3)

The lines l_1 and l_2 cross the line $y = 1$ at the points A and B respectively.

(c) Find the area of triangle ABP.

(4)

Leave blank

Question 11 continued

Q11

(Total 9 marks)

TOTAL FOR PAPER: 75 MARKS

END

physicsandmathstutor.com

Centre No.						Paper Reference							Surname	Initial(s)
Candidate No.						6	6	6	3	/	0	1	Signature	

Paper Reference(s)

6663/01

Edexcel GCE

Core Mathematics C1

Advanced Subsidiary

Wednesday 9 January 2008 – Afternoon

Time: 1 hour 30 minutes

Examiner's use only

Team Leader's use only

Question Number	Leave Blank
1	
2	
3	
4	
5	
6	
7	
8	
9	
10	
11	
Total	

Materials required for examination
Mathematical Formulae (Green)

Items included with question papers
Nil

Calculators may NOT be used in this examination.

Instructions to Candidates

In the boxes above, write your centre number, candidate number, your surname, initials and signature.
Check that you have the correct question paper.
Answer ALL the questions.
You must write your answer for each question in the space following the question.

Information for Candidates

A booklet 'Mathematical Formulae and Statistical Tables' is provided.
Full marks may be obtained for answers to ALL questions.
The marks for individual questions and the parts of questions are shown in round brackets: e.g. **(2)**.
There are 11 questions in this question paper. The total mark for this paper is 75.
There are 24 pages in this question paper. Any blank pages are indicated.

Advice to Candidates

You must ensure that your answers to parts of questions are clearly labelled.
You should show sufficient working to make your methods clear to the Examiner.
Answers without working may not gain full credit.

This publication may be reproduced only in accordance with Edexcel Limited copyright policy.
©2008 Edexcel Limited.

Printer's Log. No.
N25561A
W850/R6663/57570 3/3/3/3/3/3

N 2 5 5 6 1 A 0 1 2 4

Turn over

edexcel
advancing learning, changing lives

Leave blank

1. Find $\int (3x^2 + 4x^5 - 7)\,\mathrm{d}x$.

(4)

Q1

(Total 4 marks)

Leave blank

2. (a) Write down the value of $16^{\frac{1}{4}}$.

(1)

(b) Simplify $(16x^{12})^{\frac{3}{4}}$.

(2)

Q2

(Total 3 marks)

Leave blank

3. Simplify

$$\frac{5-\sqrt{3}}{2+\sqrt{3}},$$

giving your answer in the form $a + b\sqrt{3}$, where a and b are integers.

(4)

Q3

(Total 4 marks)

Leave blank

4. The point A (–6, 4) and the point B (8, –3) lie on the line L.

(a) Find an equation for L in the form $ax + by + c = 0$, where a, b and c are integers.
(4)

(b) Find the distance AB, giving your answer in the form $k\sqrt{5}$, where k is an integer.
(3)

Q4

(Total 7 marks)

Leave blank

5. (a) Write $\dfrac{2\sqrt{x}+3}{x}$ in the form $2x^p+3x^q$ where p and q are constants.

(2)

Given that $y = 5x - 7 + \dfrac{2\sqrt{x}+3}{x}$, $\quad x > 0$,

(b) find $\dfrac{dy}{dx}$, simplifying the coefficient of each term.

(4)

Leave blank

6.

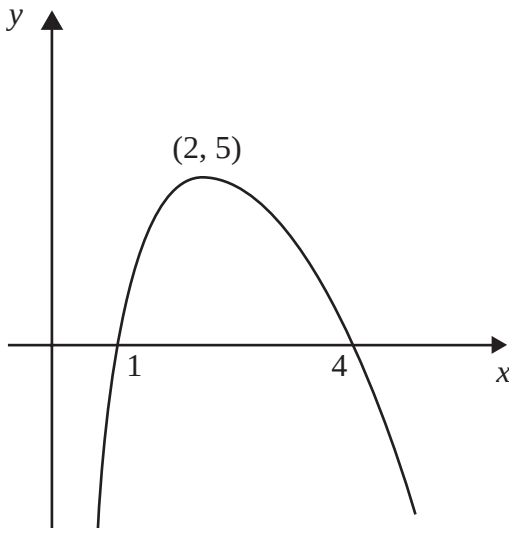

Figure 1

Figure 1 shows a sketch of the curve with equation $y = \mathrm{f}(x)$. The curve crosses the x-axis at the points (1, 0) and (4, 0). The maximum point on the curve is (2, 5).
In separate diagrams sketch the curves with the following equations.
On each diagram show clearly the coordinates of the maximum point and of each point at which the curve crosses the x-axis.

(a) $y = 2\mathrm{f}(x)$,

(3)

(b) $y = \mathrm{f}(-x)$.

(3)

The maximum point on the curve with equation $y = \mathrm{f}(x + a)$ is on the y-axis.

(c) Write down the value of the constant a.

(1)

N 2 5 5 6 1 A 0 8 2 4

Leave blank

Question 6 continued

Q6

(Total 7 marks)

Leave blank

7. A sequence is given by:

$$x_1 = 1,$$
$$x_{n+1} = x_n(p + x_n),$$

where p is a constant ($p \neq 0$).

(a) Find x_2 in terms of p.

(1)

(b) Show that $x_3 = 1 + 3p + 2p^2$.

(2)

Given that $x_3 = 1$,

(c) find the value of p,

(3)

(d) write down the value of x_{2008}.

(2)

N 2 5 5 6 1 A 0 1 0 2 4

Leave blank

Question 7 continued

Q7

(Total 8 marks)

Leave blank

8. The equation

$$x^2 + kx + 8 = k$$

has no real solutions for x.

(a) Show that k satisfies $k^2 + 4k - 32 < 0$.

(3)

(b) Hence find the set of possible values of k.

(4)

Leave blank

9. The curve C has equation $y = \mathrm{f}(x)$, $x > 0$, and $\mathrm{f}'(x) = 4x - 6\sqrt{x} + \dfrac{8}{x^2}$.

Given that the point $P(4, 1)$ lies on C,

(a) find $\mathrm{f}(x)$ and simplify your answer.

(6)

(b) Find an equation of the normal to C at the point $P(4, 1)$.

(4)

N 2 5 5 6 1 A 0 1 4 2 4

Leave blank

Question 9 continued

Q9

(Total 10 marks)

Leave blank

10. The curve C has equation

$$y = (x+3)(x-1)^2 .$$

(a) Sketch C showing clearly the coordinates of the points where the curve meets the coordinate axes.

(4)

(b) Show that the equation of C can be written in the form

$$y = x^3 + x^2 - 5x + k,$$

where k is a positive integer, and state the value of k.

(2)

There are two points on C where the gradient of the tangent to C is equal to 3.

(c) Find the x-coordinates of these two points.

(6)

Leave blank

Question 10 continued

Q10

(Total 12 marks)

Leave blank

11. The first term of an arithmetic sequence is 30 and the common difference is –1.5

(a) Find the value of the 25th term.

(2)

The rth term of the sequence is 0.

(b) Find the value of r.

(2)

The sum of the first n terms of the sequence is S_n.

(c) Find the largest positive value of S_n.

(3)

Leave blank

Question 11 continued

Q11

(Total 7 marks)

TOTAL FOR PAPER: 75 MARKS

END

N 2 5 5 6 1 A 0 2 3 2 4

physicsandmathstutor.com

Centre No.						Paper Reference							Surname	Initial(s)
Candidate No.						6	6	6	3	/	0	1	Signature	

Paper Reference(s)

6663/01

Edexcel GCE

Core Mathematics C1

Advanced Subsidiary

Monday 2 June 2008 – Morning

Time: 1 hour 30 minutes

Examiner's use only

Team Leader's use only

Question Number	Leave Blank
1	
2	
3	
4	
5	
6	
7	
8	
9	
10	
11	
Total	

Materials required for examination
Mathematical Formulae (Green)

Items included with question papers
Nil

Calculators may NOT be used in this examination.

Instructions to Candidates

In the boxes above, write your centre number, candidate number, your surname, initials and signature.
Check that you have the correct question paper.
Answer ALL the questions.
You must write your answer for each question in the space following the question.

Information for Candidates

A booklet 'Mathematical Formulae and Statistical Tables' is provided.
Full marks may be obtained for answers to ALL questions.
The marks for individual questions and the parts of questions are shown in round brackets: e.g. **(2)**.
There are 11 questions in this question paper. The total mark for this paper is 75.
There are 28 pages in this question paper. Any blank pages are indicated.

Advice to Candidates

You must ensure that your answers to parts of questions are clearly labelled.
You should show sufficient working to make your methods clear to the Examiner.
Answers without working may not gain full credit.

This publication may be reproduced only in accordance with Edexcel Limited copyright policy.
©2008 Edexcel Limited.

Printer's Log. No.
H29992A
W850/R6663/57570 3/3/3/3/

H 2 9 9 9 2 A 0 1 2 8

Turn over

edexcel
advancing learning, changing lives

Leave blank

1. Find $\int (2 + 5x^2)\, dx$.

(3)

Q1

(Total 3 marks)

Leave blank

2. Factorise completely

$$x^3 - 9x.$$

(3)

Q2

(Total 3 marks)

Leave blank

3.

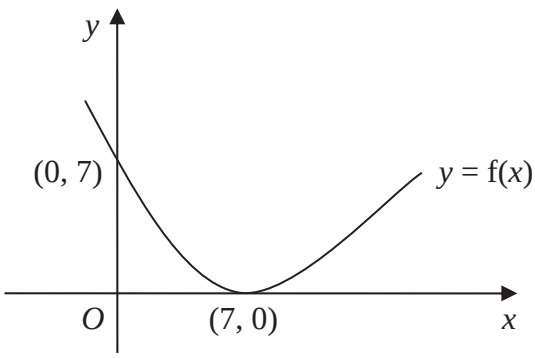

Figure 1

Figure 1 shows a sketch of the curve with equation $y = \mathrm{f}(x)$. The curve passes through the point (0, 7) and has a minimum point at (7, 0).

On separate diagrams, sketch the curve with equation

(a) $y = \mathrm{f}(x) + 3$,

(3)

(b) $y = \mathrm{f}(2x)$.

(2)

On each diagram, show clearly the coordinates of the minimum point and the coordinates of the point at which the curve crosses the y-axis.

Leave blank

4. $$f(x) = 3x + x^3, \qquad x > 0.$$

(a) Differentiate to find $f'(x)$.

(2)

Given that $f'(x) = 15$,

(b) find the value of x.

(3)

Leave blank

5. A sequence $x_1, x_2, x_3, \ldots$ is defined by

$$x_1 = 1,$$

$$x_{n+1} = ax_n - 3, \quad n \geqslant 1,$$

where a is a constant.

(a) Find an expression for x_2 in terms of a.

(1)

(b) Show that $x_3 = a^2 - 3a - 3$.

(2)

Given that $x_3 = 7$,

(c) find the possible values of a.

(3)

Leave blank

6. The curve C has equation $y = \frac{3}{x}$ and the line l has equation $y = 2x + 5$.

(a) On the axes below, sketch the graphs of C and l, indicating clearly the coordinates of any intersections with the axes.

(3)

(b) Find the coordinates of the points of intersection of C and l.

(6)

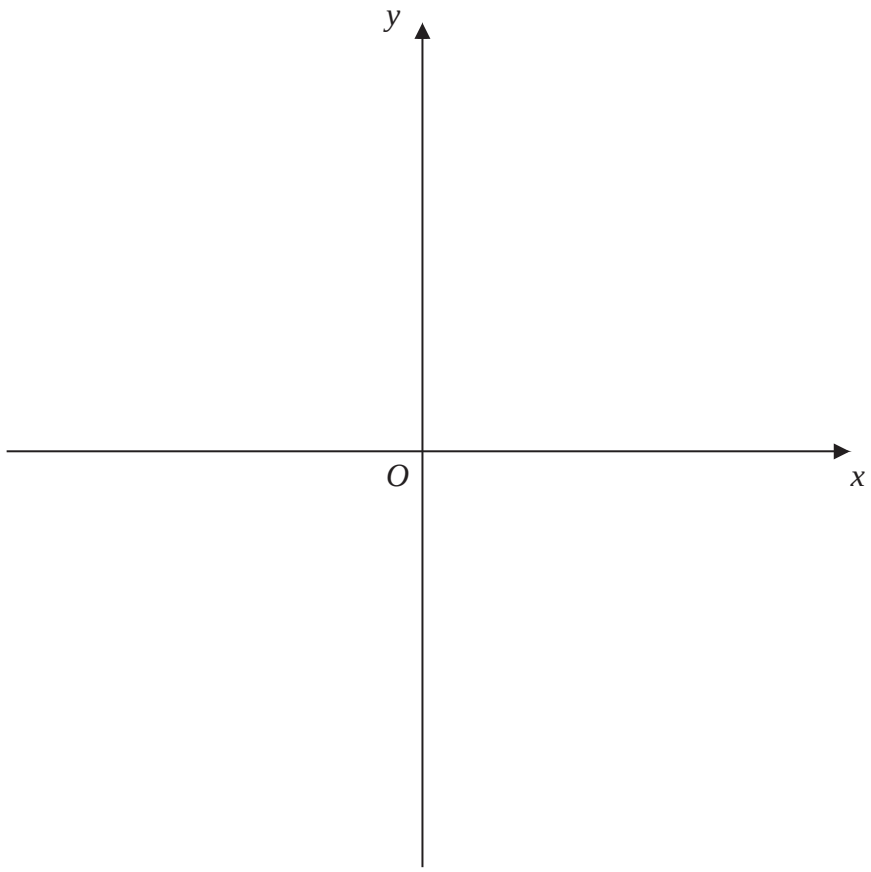

Leave blank

Question 6 continued

Q6

(Total 9 marks)

Leave blank

7. Sue is training for a marathon. Her training includes a run every Saturday starting with a run of 5 km on the first Saturday. Each Saturday she increases the length of her run from the previous Saturday by 2 km.

(a) Show that on the 4th Saturday of training she runs 11 km.
(1)

(b) Find an expression, in terms of n, for the length of her training run on the nth Saturday.
(2)

(c) Show that the total distance she runs on Saturdays in n weeks of training is $n(n + 4)$ km.
(3)

On the nth Saturday Sue runs 43 km.

(d) Find the value of n.
(2)

(e) Find the total distance, in km, Sue runs on Saturdays in n weeks of training.
(2)

Leave blank

Question 7 continued

Leave blank

8. Given that the equation $2qx^2 + qx - 1 = 0$, where q is a constant, has no real roots,

(a) show that $q^2 + 8q < 0$.

(2)

(b) Hence find the set of possible values of q.

(3)

Leave blank

9. The curve C has equation $y = kx^3 - x^2 + x - 5$, where k is a constant.

(a) Find $\frac{dy}{dx}$.

(2)

The point A with x-coordinate $-\frac{1}{2}$ lies on C. The tangent to C at A is parallel to the line with equation $2y - 7x + 1 = 0$.

Find

(b) the value of k,

(4)

(c) the value of the y-coordinate of A.

(2)

Leave blank

Question 9 continued

Leave blank

10.

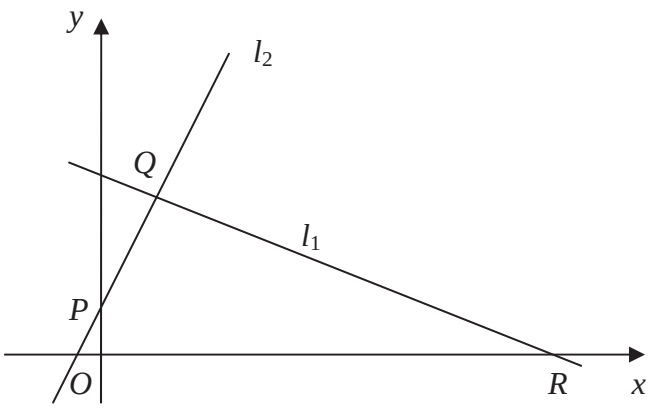

Figure 2

The points Q (1, 3) and R (7, 0) lie on the line l_1, as shown in Figure 2.

The length of QR is $a\sqrt{5}$.

(a) Find the value of a.

(3)

The line l_2 is perpendicular to l_1, passes through Q and crosses the y-axis at the point P, as shown in Figure 2.

Find

(b) an equation for l_2,

(5)

(c) the coordinates of P,

(1)

(d) the area of ΔPQR.

(4)

H 2 9 9 9 2 A 0 2 2 2 8

Leave blank

Question 10 continued

Leave blank

11. The gradient of a curve C is given by $\frac{dy}{dx} = \frac{(x^2+3)^2}{x^2}$, $x \neq 0$.

(a) Show that $\frac{dy}{dx} = x^2 + 6 + 9x^{-2}$.

(2)

The point (3, 20) lies on C.

(b) Find an equation for the curve C in the form $y = f(x)$.

(6)

Leave blank

Question 11 continued

Q11

(Total 8 marks)

TOTAL FOR PAPER: 75 MARKS

END

physicsandmathstutor.com

Centre No.						Paper Reference							Surname	Initial(s)
Candidate No.						6	6	6	3	/	0	1	Signature	

Paper Reference(s)

6663/01

Edexcel GCE

Core Mathematics C1

Advanced Subsidiary

Friday 9 January 2009 – Morning

Time: 1 hour 30 minutes

Examiner's use only

Team Leader's use only

Question Number	Leave Blank
1	
2	
3	
4	
5	
6	
7	
8	
9	
10	
11	
Total	

Materials required for examination
Mathematical Formulae (Green)

Items included with question papers
Nil

Calculators may NOT be used in this examination.

Instructions to Candidates

In the boxes above, write your centre number, candidate number, your surname, initials and signature.
Check that you have the correct question paper.
Answer ALL the questions.
You must write your answer for each question in the space following the question.

Information for Candidates

A booklet 'Mathematical Formulae and Statistical Tables' is provided.
Full marks may be obtained for answers to ALL questions.
The marks for individual questions and the parts of questions are shown in round brackets: e.g. **(2)**.
There are 11 questions in this question paper. The total mark for this paper is 75.
There are 28 pages in this question paper. Any blank pages are indicated.

Advice to Candidates

You must ensure that your answers to parts of questions are clearly labelled.
You should show sufficient working to make your methods clear to the Examiner.
Answers without working may not gain full credit.

This publication may be reproduced only in accordance with Edexcel Limited copyright policy.
©2009 Edexcel Limited.

Printer's Log. No.
N30081A
W850/R6663/57570 3/3/3/3

N 3 0 0 8 1 A 0 1 2 8

Turn over

edexcel
advancing learning, changing lives

Leave blank

1. (a) Write down the value of $125^{\frac{1}{3}}$.

(1)

(b) Find the value of $125^{-\frac{2}{3}}$.

(2)

Q1

(Total 3 marks)

Leave blank

2. Find $\int \left(12x^5 - 8x^3 + 3\right) \mathrm{d}x$, giving each term in its simplest form.

(4)

Q2

(Total 4 marks)

N 3 0 0 8 1 A 0 4 2 8

Leave blank

3. Expand and simplify $(\sqrt{7} + 2)(\sqrt{7} - 2)$.

(2)

Q3

(Total 2 marks)

Leave blank

4. A curve has equation $y = \mathrm{f}(x)$ and passes through the point (4, 22).

Given that

$$\mathrm{f}'(x) = 3x^2 - 3x^{\frac{1}{2}} - 7,$$

use integration to find $\mathrm{f}(x)$, giving each term in its simplest form.

(5)

N 3 0 0 8 1 A 0 6 2 8

Leave blank

5.

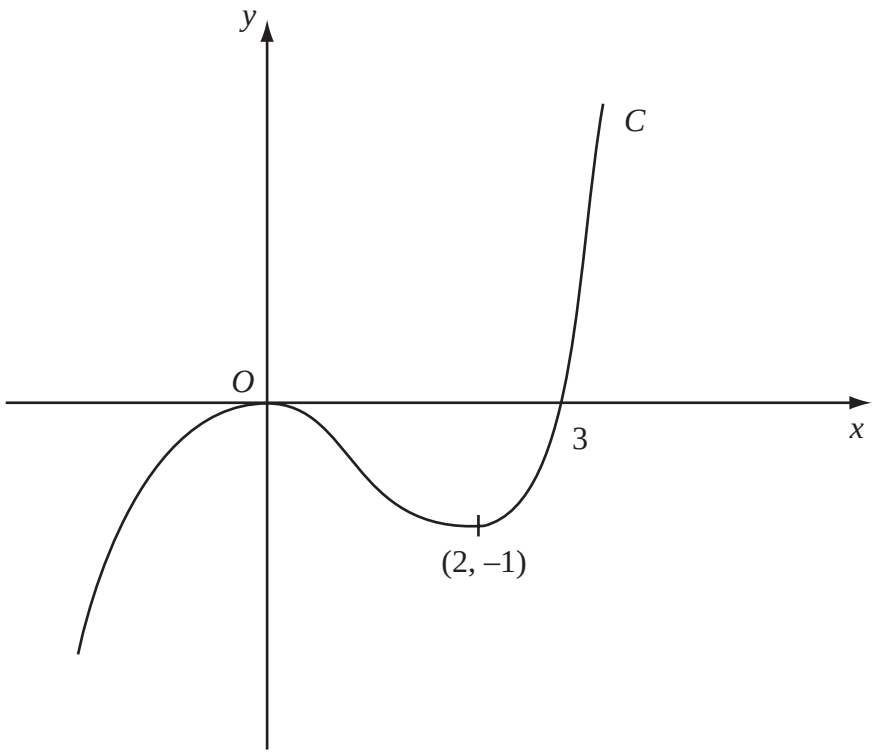

Figure 1

Figure 1 shows a sketch of the curve C with equation $y = \mathrm{f}(x)$. There is a maximum at (0, 0), a minimum at (2, –1) and C passes through (3, 0).

On separate diagrams sketch the curve with equation

(a) $y = \mathrm{f}(x + 3)$,

(3)

(b) $y = \mathrm{f}(-x)$.

(3)

On each diagram show clearly the coordinates of the maximum point, the minimum point and any points of intersection with the x-axis.

Leave blank

Question 5 continued

Q5

(Total 6 marks)

Leave blank

6. Given that $\dfrac{2x^2 - x^{\frac{3}{2}}}{\sqrt{x}}$ can be written in the form $2x^p - x^q$,

(a) write down the value of p and the value of q.

(2)

Given that $y = 5x^4 - 3 + \dfrac{2x^2 - x^{\frac{3}{2}}}{\sqrt{x}}$,

(b) find $\dfrac{dy}{dx}$, simplifying the coefficient of each term.

(4)

N 3 0 0 8 1 A 0 1 0 2 8

Leave blank

7. The equation $kx^2 + 4x + (5 - k) = 0$, where k is a constant, has 2 different real solutions for x.

(a) Show that k satisfies

$$k^2 - 5k + 4 > 0.$$

(3)

(b) Hence find the set of possible values of k.

(4)

Leave blank

8. The point P (1, a) lies on the curve with equation $y = (x + 1)^2(2 - x)$.

(a) Find the value of a.

(1)

(b) On the axes below sketch the curves with the following equations:

(i) $y = (x + 1)^2(2 - x)$,

(ii) $y = \frac{2}{x}$.

On your diagram show clearly the coordinates of any points at which the curves meet the axes.

(5)

(c) With reference to your diagram in part (b) state the number of real solutions to the equation

$$(x+1)^2(2-x) = \frac{2}{x}.$$

(1)

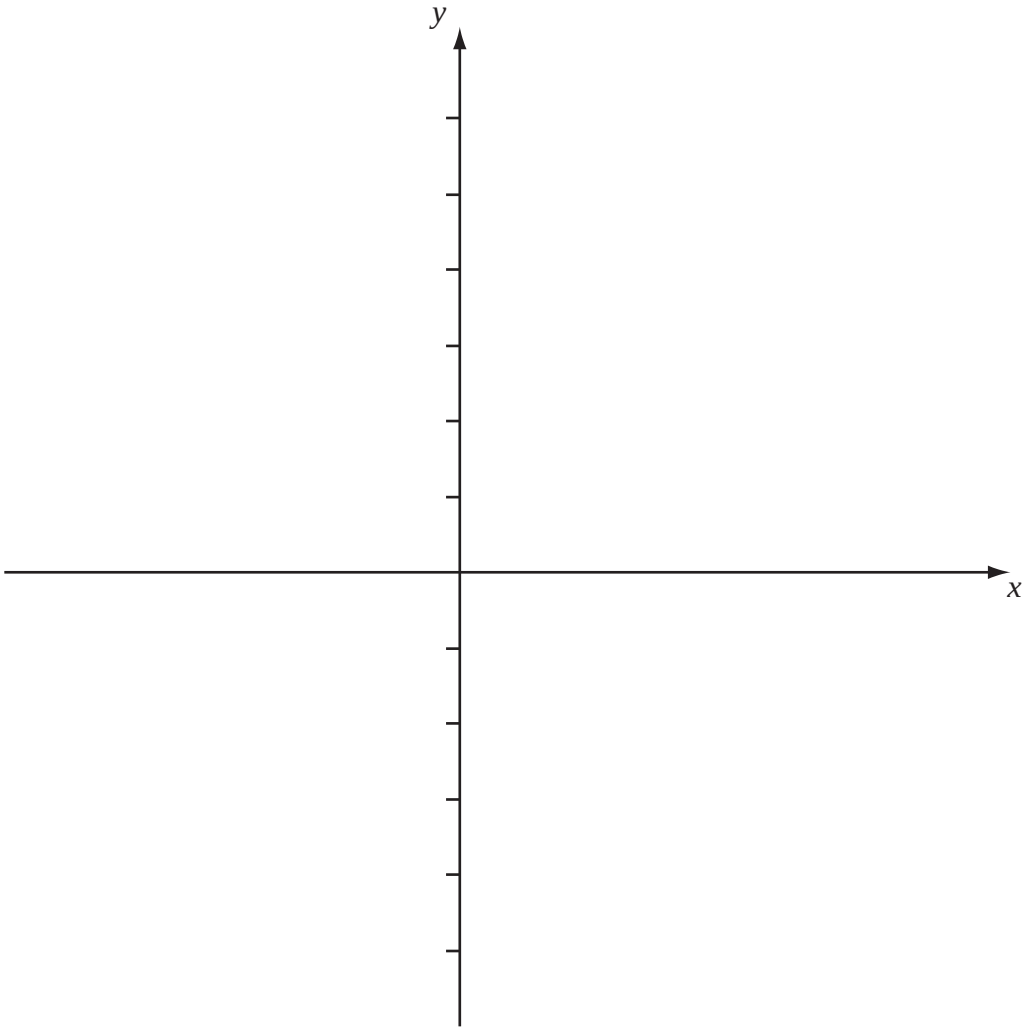

N 3 0 0 8 1 A 0 1 4 2 8

Leave blank

Question 8 continued

Q8

(Total 7 marks)

Leave blank

9. The first term of an arithmetic series is a and the common difference is d.

The 18th term of the series is 25 and the 21st term of the series is $32\frac{1}{2}$.

(a) Use this information to write down two equations for a and d.

(2)

(b) Show that $a = -17.5$ and find the value of d.

(2)

The sum of the first n terms of the series is 2750.

(c) Show that n is given by

$$n^2 - 15n = 55 \times 40.$$

(4)

(d) Hence find the value of n.

(3)

N 3 0 0 8 1 A 0 1 6 2 8

Leave blank

Question 9 continued

Q9

(Total 11 marks)

Leave blank

10. The line l_1 passes through the point A (2, 5) and has gradient $-\frac{1}{2}$.

(a) Find an equation of l_1, giving your answer in the form $y = mx + c$.

(3)

The point B has coordinates (–2, 7).

(b) Show that B lies on l_1.

(1)

(c) Find the length of AB, giving your answer in the form $k\sqrt{5}$, where k is an integer.

(3)

The point C lies on l_1 and has x-coordinate equal to p.

The length of AC is 5 units.

(d) Show that p satisfies

$$p^2 - 4p - 16 = 0.$$

(4)

N 3 0 0 8 1 A 0 2 0 2 8

Leave blank

Question 10 continued

Q10

(Total 11 marks)

Leave blank

11. The curve C has equation

$$y = 9 - 4x - \frac{8}{x}, \qquad x > 0 .$$

The point P on C has x-coordinate equal to 2.

(a) Show that the equation of the tangent to C at the point P is $y = 1 - 2x$.

(6)

(b) Find an equation of the normal to C at the point P.

(3)

The tangent at P meets the x-axis at A and the normal at P meets the x-axis at B.

(c) Find the area of triangle APB.

(4)

Leave blank

Question 11 continued

Q11

(Total 13 marks)

TOTAL FOR PAPER: 75 MARKS

END

N 3 0 0 8 1 A 0 2 7 2 8

physicsandmathstutor.com

Centre No.						Paper Reference							Surname	Initial(s)
Candidate No.						6	6	6	3	/	0	1	Signature	

Paper Reference(s)

6663/01

Edexcel GCE

Core Mathematics C1

Advanced Subsidiary

Friday 5 June 2009 – Afternoon

Time: 1 hour 30 minutes

Examiner's use only

Team Leader's use only

Question Number	Leave Blank
1	
2	
3	
4	
5	
6	
7	
8	
9	
10	
11	
Total	

Materials required for examination
Mathematical Formulae
(Orange or Green)

Items included with question papers
Nil

Calculators may NOT be used in this examination.

Instructions to Candidates

In the boxes above, write your centre number, candidate number, your surname, initials and signature.
Check that you have the correct question paper.
Answer ALL the questions.
You must write your answer for each question in the space following the question.

Information for Candidates

A booklet 'Mathematical Formulae and Statistical Tables' is provided.
Full marks may be obtained for answers to ALL questions.
The marks for individual questions and the parts of questions are shown in round brackets: e.g. **(2)**.
There are 11 questions in this question paper. The total mark for this paper is 75.
There are 28 pages in this question paper. Any blank pages are indicated.

Advice to Candidates

You must ensure that your answers to parts of questions are clearly labelled.
You should show sufficient working to make your methods clear to the Examiner.
Answers without working may not gain full credit.

This publication may be reproduced only in accordance with Edexcel Limited copyright policy.
©2009 Edexcel Limited.

Printer's Log. No.
H34262A
W850/R6663/57570 3/5/4

H 3 4 2 6 2 A 0 1 2 8

Turn over

edexcel
advancing learning, changing lives

Leave blank

1. Simplify

(a) $\left(3\sqrt{7}\right)^2$

(1)

(b) $\left(8+\sqrt{5}\right)\left(2-\sqrt{5}\right)$

(3)

Q1

(Total 4 marks)

Leave blank

2. Given that $32\sqrt{2} = 2^a$, find the value of a.

(3)

Q2

(Total 3 marks)

Leave blank

3. Given that $y = 2x^3 + \frac{3}{x^2}$, $x \neq 0$, find

(a) $\frac{dy}{dx}$

(3)

(b) $\int y \, dx$, simplifying each term.

(3)

Leave blank

4. Find the set of values of x for which

(a) $4x - 3 > 7 - x$

(2)

(b) $2x^2 - 5x - 12 < 0$

(4)

(c) **both** $4x - 3 > 7 - x$ **and** $2x^2 - 5x - 12 < 0$

(1)

Leave blank

5. A 40-year building programme for new houses began in Oldtown in the year 1951 (Year 1) and finished in 1990 (Year 40).

The numbers of houses built each year form an arithmetic sequence with first term a and common difference d.

Given that 2400 new houses were built in 1960 and 600 new houses were built in 1990, find

(a) the value of d,

(3)

(b) the value of a,

(2)

(c) the total number of houses built in Oldtown over the 40-year period.

(3)

Leave blank

6. The equation $x^2 + 3px + p = 0$, where p is a non-zero constant, has equal roots.

Find the value of p.

(4)

Leave blank

7. A sequence $a_1, a_2, a_3, \ldots$ is defined by

$$a_1 = k,$$

$$a_{n+1} = 2a_n - 7, \qquad n \geqslant 1,$$

where k is a constant.

(a) Write down an expression for a_2 in terms of k.

(1)

(b) Show that $a_3 = 4k - 21$.

(2)

Given that $\sum_{r=1}^{4} a_r = 43$,

(c) find the value of k.

(4)

H 3 4 2 6 2 A 0 1 2 2 8

Leave blank

8.

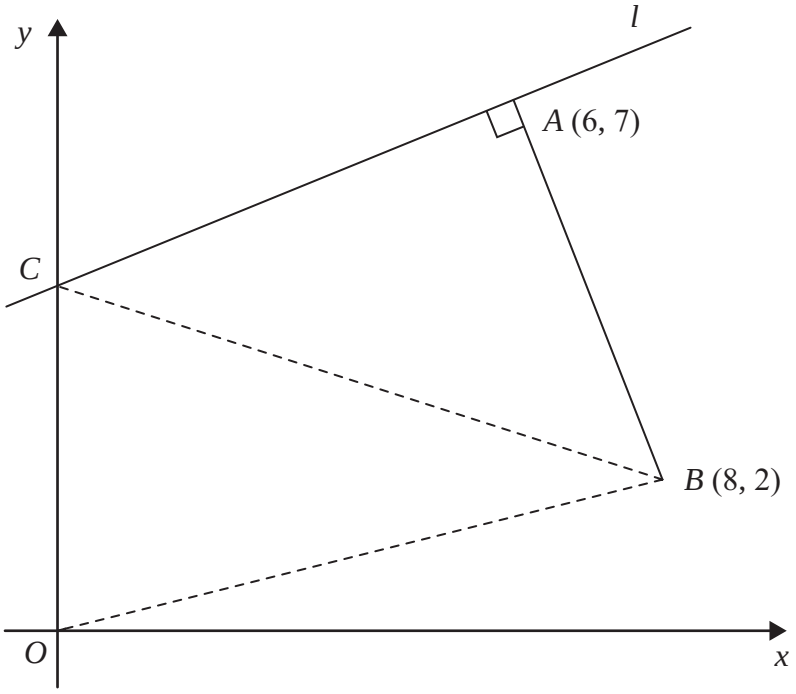

Figure 1

The points A and B have coordinates (6, 7) and (8, 2) respectively.

The line l passes through the point A and is perpendicular to the line AB, as shown in Figure 1.

(a) Find an equation for l in the form $ax + by + c = 0$, where a, b and c are integers.
(4)

Given that l intersects the y-axis at the point C, find

(b) the coordinates of C,
(2)

(c) the area of ΔOCB, where O is the origin.
(2)

H 3 4 2 6 2 A 0 1 4 2 8

Leave blank

Question 8 continued

Leave blank

9.

$$f(x) = \frac{\left(3 - 4\sqrt{x}\right)^2}{\sqrt{x}}, \qquad x > 0$$

(a) Show that $f(x) = 9x^{-\frac{1}{2}} + Ax^{\frac{1}{2}} + B$, where A and B are constants to be found.

(3)

(b) Find $f'(x)$.

(3)

(c) Evaluate $f'(9)$.

(2)

Leave blank

10. (a) Factorise completely $x^3 - 6x^2 + 9x$

(3)

(b) Sketch the curve with equation

$$y = x^3 - 6x^2 + 9x$$

showing the coordinates of the points at which the curve meets the x-axis.

(4)

Using your answer to part (b), or otherwise,

(c) sketch, on a separate diagram, the curve with equation

$$y = (x - 2)^3 - 6(x - 2)^2 + 9(x - 2)$$

showing the coordinates of the points at which the curve meets the x-axis.

(2)

Leave blank

Question 10 continued

Leave blank

11. The curve C has equation

$$y = x^3 - 2x^2 - x + 9, \qquad x > 0$$

The point P has coordinates (2, 7).

(a) Show that P lies on C.

(1)

(b) Find the equation of the tangent to C at P, giving your answer in the form $y = mx + c$, where m and c are constants.

(5)

The point Q also lies on C.

Given that the tangent to C at Q is perpendicular to the tangent to C at P,

(c) show that the x-coordinate of Q is $\frac{1}{3}\left(2 + \sqrt{6}\right)$.

(5)

Leave blank

Question 11 continued

Q11

(Total 11 marks)

TOTAL FOR PAPER: 75 MARKS

END

physicsandmathstutor.com

Centre No.						Paper Reference							Surname	Initial(s)
Candidate No.						6	6	6	3	/	0	1	Signature	

Paper Reference(s)

6663/01

Edexcel GCE

Core Mathematics C1

Advanced Subsidiary

Monday 11 January 2010 – Morning

Time: 1 hour 30 minutes

Examiner's use only

Team Leader's use only

Question Number	Leave Blank
1	
2	
3	
4	
5	
6	
7	
8	
9	
10	
Total	

Materials required for examination
Mathematical Formulae (Pink or Green)

Items included with question papers
Nil

Calculators may NOT be used in this examination.

Instructions to Candidates

In the boxes above, write your centre number, candidate number, your surname, initials and signature.
Check that you have the correct question paper.
Answer ALL the questions.
You must write your answer to each question in the space following the question.

Information for Candidates

A booklet 'Mathematical Formulae and Statistical Tables' is provided.
Full marks may be obtained for answers to ALL questions.
The marks for individual questions and the parts of questions are shown in round brackets: e.g. **(2)**.
There are 10 questions in this question paper. The total mark for this paper is 75.
There are 28 pages in this question paper. Any blank pages are indicated.

Advice to Candidates

You must ensure that your answers to parts of questions are clearly labelled.
You should show sufficient working to make your methods clear to the Examiner.
Answers without working may not gain full credit.

This publication may be reproduced only in accordance with Edexcel Limited copyright policy.
©2010 Edexcel Limited.

Printer's Log. No.
N34854A
W850/R6663/57570 3/5/5/3

N 3 4 8 5 4 A 0 1 2 8

Turn over

edexcel
advancing learning, changing lives

Leave blank

1. Given that $y = x^4 + x^{\frac{1}{3}} + 3$, find $\frac{dy}{dx}$.

(3)

Q1

(Total 3 marks)

N 3 4 8 5 4 A 0 2 2 8

Leave blank

2. (a) Expand and simplify $(7 + \sqrt{5})(3 - \sqrt{5})$.

(3)

(b) Express $\dfrac{7+\sqrt{5}}{3+\sqrt{5}}$ in the form $a + b\sqrt{5}$, where a and b are integers.

(3)

Q2

(Total 6 marks)

Leave blank

3. The line l_1 has equation $3x + 5y - 2 = 0$

(a) Find the gradient of l_1.

(2)

The line l_2 is perpendicular to l_1 and passes through the point (3, 1).

(b) Find the equation of l_2 in the form $y = mx + c$, where m and c are constants.

(3)

Leave blank

4. $$\frac{dy}{dx} = 5x^{-\frac{1}{2}} + x\sqrt{x}, \qquad x > 0$$

Given that $y = 35$ at $x = 4$, find y in terms of x, giving each term in its simplest form.

(7)

Leave blank

5. Solve the simultaneous equations

$$y - 3x + 2 = 0$$

$$y^2 - x - 6x^2 = 0$$

(7)

Leave blank

6. The curve C has equation

$$y = \frac{(x+3)(x-8)}{x} \quad , \quad x > 0$$

(a) Find $\frac{dy}{dx}$ in its simplest form.

(4)

(b) Find an equation of the tangent to C at the point where $x = 2$

(4)

Leave blank

7. Jill gave money to a charity over a 20-year period, from Year 1 to Year 20 inclusive. She gave £150 in Year 1, £160 in Year 2, £170 in Year 3, and so on, so that the amounts of money she gave each year formed an arithmetic sequence.

(a) Find the amount of money she gave in Year 10.

(2)

(b) Calculate the total amount of money she gave over the 20-year period.

(3)

Kevin also gave money to the charity over the same 20-year period.

He gave £A in Year 1 and the amounts of money he gave each year increased, forming an arithmetic sequence with common difference £30.
The total amount of money that Kevin gave over the 20-year period was **twice** the total amount of money that Jill gave.

(c) Calculate the value of A.

(4)

Leave blank

Question 7 continued

Q7

(Total 9 marks)

Leave blank

8.

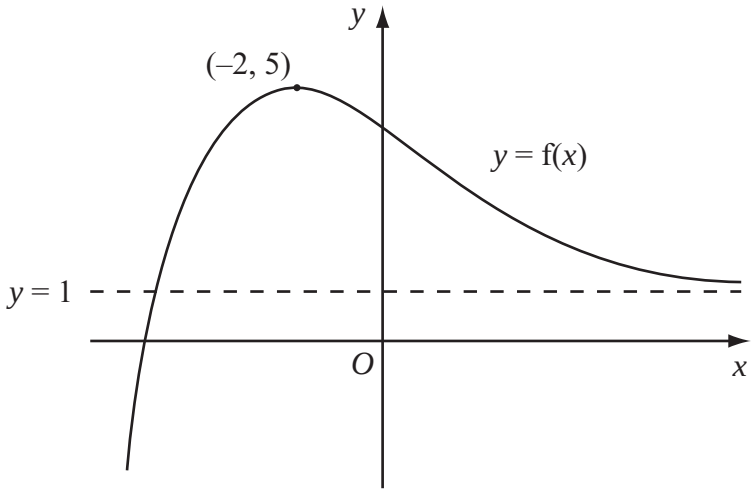

Figure 1

Figure 1 shows a sketch of part of the curve with equation $y = \mathrm{f}(x)$.

The curve has a maximum point (–2, 5) and an asymptote $y = 1$, as shown in Figure 1.

On separate diagrams, sketch the curve with equation

(a) $y = \mathrm{f}(x) + 2$

(2)

(b) $y = 4\mathrm{f}(x)$

(2)

(c) $y = \mathrm{f}(x + 1)$

(3)

On each diagram, show clearly the coordinates of the maximum point and the equation of the asymptote.

N 3 4 8 5 4 A 0 1 6 2 8

Leave blank

Question 8 continued

Q8

(Total 7 marks)

Leave blank

9. (a) Factorise completely $x^3 - 4x$

(3)

(b) Sketch the curve C with equation

$$y = x^3 - 4x,$$

showing the coordinates of the points at which the curve meets the x-axis.

(3)

The point A with x-coordinate -1 and the point B with x-coordinate 3 lie on the curve C.

(c) Find an equation of the line which passes through A and B, giving your answer in the form $y = mx + c$, where m and c are constants.

(5)

(d) Show that the length of AB is $k\sqrt{10}$, where k is a constant to be found.

(2)

N 3 4 8 5 4 A 0 2 0 2 8

Leave blank

Question 9 continued

Leave blank

10. $$f(x) = x^2 + 4kx + (3 + 11k), \quad \text{where } k \text{ is a constant.}$$

(a) Express f(x) in the form $(x + p)^2 + q$, where p and q are constants to be found in terms of k.

(3)

Given that the equation f(x) = 0 has no real roots,

(b) find the set of possible values of k.

(4)

Given that $k = 1$,

(c) sketch the graph of y = f(x), showing the coordinates of any point at which the graph crosses a coordinate axis.

(3)

Leave blank

Question 10 continued

Q10

(Total 10 marks)

TOTAL FOR PAPER: 75 MARKS

END

N 3 4 8 5 4 A 0 2 7 2 8

physicsandmathstutor.com

Centre No.						Paper Reference							Surname	Initial(s)
Candidate No.						6	6	6	3	/	0	1	Signature	

Paper Reference(s)

6663/01

Edexcel GCE

Core Mathematics C1

Advanced Subsidiary

Monday 24 May 2010 – Afternoon

Time: 1 hour 30 minutes

Examiner's use only

Team Leader's use only

Question Number	Leave Blank
1	
2	
3	
4	
5	
6	
7	
8	
9	
10	
11	
Total	

Materials required for examination
Mathematical Formulae (Pink)

Items included with question papers
Nil

Calculators may NOT be used in this examination.

Instructions to Candidates

In the boxes above, write your centre number, candidate number, your surname, initials and signature.
Check that you have the correct question paper.
Answer ALL the questions.
You must write your answer to each question in the space following the question.

Information for Candidates

A booklet 'Mathematical Formulae and Statistical Tables' is provided.
Full marks may be obtained for answers to ALL questions.
The marks for individual questions and the parts of questions are shown in round brackets: e.g. **(2)**.
There are 11 questions in this question paper. The total mark for this paper is 75.
There are 28 pages in this question paper. Any blank pages are indicated.

Advice to Candidates

You must ensure that your answers to parts of questions are clearly labelled.
You should show sufficient working to make your methods clear to the Examiner.
Answers without working may not gain full credit.

This publication may be reproduced only in accordance with Edexcel Limited copyright policy.
©2010 Edexcel Limited.

Printer's Log. No.
H35383A
W850/R6663/57570 4/5

H 3 5 3 8 3 A 0 1 2 8

Turn over

edexcel
advancing learning, changing lives

Leave blank

1. Write

$$\sqrt{(75)} - \sqrt{(27)}$$

in the form $k\sqrt{x}$, where k and x are integers.

(2)

Q1

(Total 2 marks)

Leave blank

2. Find

$$\int (8x^3 + 6x^{\frac{1}{2}} - 5)\,\mathrm{d}x$$

giving each term in its simplest form.

(4)

Q2

(Total 4 marks)

Leave blank

3. Find the set of values of x for which

(a) $3(x-2) < 8-2x$

(2)

(b) $(2x-7)(1+x) < 0$

(3)

(c) both $3(x-2) < 8-2x$ **and** $(2x-7)(1+x) < 0$

(1)

Leave blank

4. (a) Show that $x^2 + 6x + 11$ can be written as

$$(x + p)^2 + q$$

where p and q are integers to be found.

(2)

(b) In the space at the top of page 7, sketch the curve with equation $y = x^2 + 6x + 11$, showing clearly any intersections with the coordinate axes.

(2)

(c) Find the value of the discriminant of $x^2 + 6x + 11$

(2)

Leave blank

Question 4 continued

Q4

(Total 6 marks)

Leave blank

5. A sequence of positive numbers is defined by

$$a_{n+1} = \sqrt{(a_n^2 + 3)}, \qquad n \geqslant 1,$$
$$a_1 = 2$$

(a) Find a_2 and a_3, leaving your answers in surd form.

(2)

(b) Show that $a_5 = 4$

(2)

Leave blank

6.

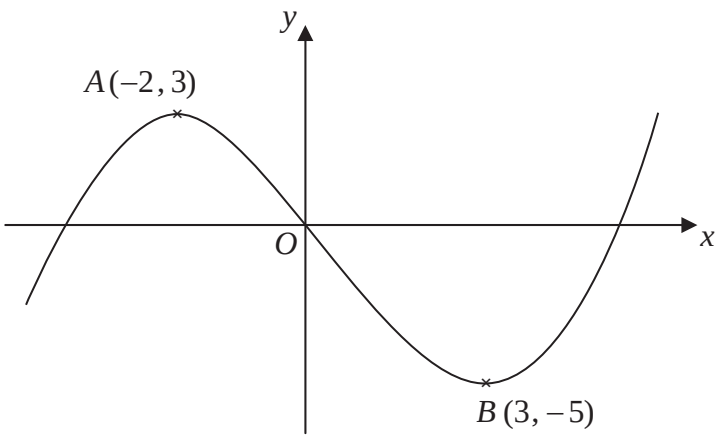

Figure 1

Figure 1 shows a sketch of the curve with equation $y = \mathrm{f}(x)$. The curve has a maximum point A at (–2, 3) and a minimum point B at (3, –5).

On separate diagrams sketch the curve with equation

(a) $y = \mathrm{f}(x+3)$

(3)

(b) $y = 2\mathrm{f}(x)$

(3)

On each diagram show clearly the coordinates of the maximum and minimum points.

The graph of $y = \mathrm{f}(x)+a$ has a minimum at (3, 0), where a is a constant.

(c) Write down the value of a.

(1)

Leave blank

Question 6 continued

Q6

(Total 7 marks)

Leave blank

7. Given that

$$y = 8x^3 - 4\sqrt{x} + \frac{3x^2 + 2}{x}, \quad x > 0$$

find $\frac{dy}{dx}$.

(6)

Leave blank

8. (a) Find an equation of the line joining $A(7, 4)$ and $B(2, 0)$, giving your answer in the form $ax+by+c=0$, where a, b and c are integers.

(3)

(b) Find the length of AB, leaving your answer in surd form.

(2)

The point C has coordinates $(2, t)$, where $t > 0$, and $AC = AB$.

(c) Find the value of t.

(1)

(d) Find the area of triangle ABC.

(2)

Leave blank

Question 8 continued

Leave blank

9. A farmer has a pay scheme to keep fruit pickers working throughout the 30 day season. He pays £a for their first day, £$(a + d)$ for their second day, £$(a + 2d)$ for their third day, and so on, thus increasing the daily payment by £d for each extra day they work.

A picker who works for all 30 days will earn £40.75 on the final day.

(a) Use this information to form an equation in a and d.

(2)

A picker who works for all 30 days will earn a total of £1005

(b) Show that $15(a + 40.75) = 1005$

(2)

(c) Hence find the value of a and the value of d.

(4)

Leave blank

10. (a) On the axes below sketch the graphs of

(i) $y = x(4-x)$

(ii) $y = x^2(7-x)$

showing clearly the coordinates of the points where the curves cross the coordinate axes.

(5)

(b) Show that the x-coordinates of the points of intersection of

$$y = x(4-x) \quad \text{and} \quad y = x^2(7-x)$$

are given by the solutions to the equation $x(x^2 - 8x + 4) = 0$

(3)

The point A lies on both of the curves and the x and y coordinates of A are both positive.

(c) Find the exact coordinates of A, leaving your answer in the form $(p + q\sqrt{3},\ r + s\sqrt{3})$, where p, q, r and s are integers.

(7)

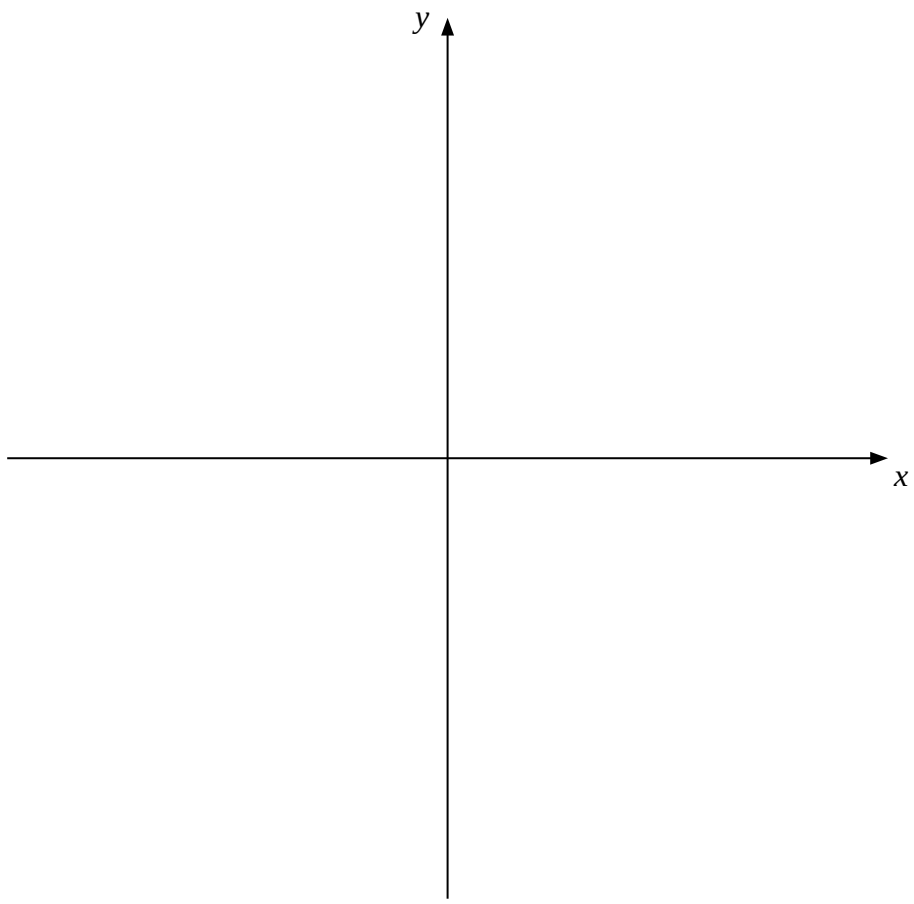

H 3 5 3 8 3 A 0 2 2 2 8

Leave blank

Question 10 continued

Leave blank

11. The curve C has equation $y = \mathrm{f}(x)$, $x > 0$, where

$$\frac{\mathrm{d}y}{\mathrm{d}x} = 3x - \frac{5}{\sqrt{x}} - 2$$

Given that the point $P(4, 5)$ lies on C, find

(a) $\mathrm{f}(x)$,

(5)

(b) an equation of the tangent to C at the point P, giving your answer in the form $ax + by + c = 0$, where a, b and c are integers.

(4)

Leave blank

Question 11 continued

Q11

(Total 9 marks)

TOTAL FOR PAPER: 75 MARKS

END

physicsandmathstutor.com

Centre No.						Paper Reference							Surname	Initial(s)
Candidate No.						6	6	6	3	/	0	1	Signature	

Paper Reference(s)

6663/01

Edexcel GCE

Core Mathematics C1

Advanced Subsidiary

Monday 10 January 2011 – Morning

Time: 1 hour 30 minutes

Examiner's use only

Team Leader's use only

Question Number	Leave Blank
1	
2	
3	
4	
5	
6	
7	
8	
9	
10	
11	
Total	

Materials required for examination
Mathematical Formulae (Pink)

Items included with question papers
Nil

Calculators may NOT be used in this examination.

Instructions to Candidates

In the boxes above, write your centre number, candidate number, your surname, initials and signature.
Check that you have the correct question paper.
Answer ALL the questions.
You must write your answer to each question in the space following the question.

Information for Candidates

A booklet 'Mathematical Formulae and Statistical Tables' is provided.
Full marks may be obtained for answers to ALL questions.
The marks for individual questions and the parts of questions are shown in round brackets: e.g. **(2)**.
There are 11 questions in this question paper. The total mark for this paper is 75.
There are 24 pages in this question paper. Any blank pages are indicated.

Advice to Candidates

You must ensure that your answers to parts of questions are clearly labelled.
You should show sufficient working to make your methods clear to the Examiner.
Answers without working may not gain full credit.

This publication may be reproduced only in accordance with
Edexcel Limited copyright policy.
©2011 Edexcel Limited.

Printer's Log. No.
H35402A
W850/R6663/57570 5/5/3/2/

H 3 5 4 0 2 A 0 1 2 4

Turn over

edexcel
advancing learning, changing lives

Leave blank

1. (a) Find the value of $16^{-\frac{1}{4}}$

(2)

(b) Simplify $x\left(2x^{-\frac{1}{4}}\right)^4$

(2)

Q1

(Total 4 marks)

Leave blank

2. Find

$$\int (12x^5 - 3x^2 + 4x^{\frac{1}{3}})\ \mathrm{d}x$$

giving each term in its simplest form.

(5)

Q2

(Total 5 marks)

Leave blank

3. Simplify

$$\frac{5-2\sqrt{3}}{\sqrt{3}-1}$$

giving your answer in the form $p+q\sqrt{3}$, where p and q are rational numbers.

(4)

Leave blank

4. A sequence $a_1, a_2, a_3, \ldots$ is defined by

$$a_1 = 2$$
$$a_{n+1} = 3a_n - c$$

where c is a constant.

(a) Find an expression for a_2 in terms of c.

(1)

Given that $\sum_{i=1}^{3} a_i = 0$

(b) find the value of c.

(4)

Leave blank

5.

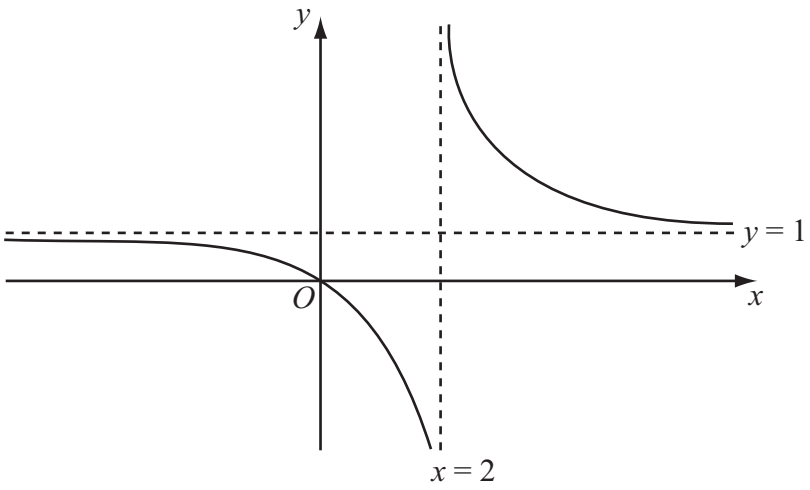

Figure 1

Figure 1 shows a sketch of the curve with equation $y = \mathrm{f}(x)$ where

$$\mathrm{f}(x) = \frac{x}{x-2}, \qquad x \neq 2$$

The curve passes through the origin and has two asymptotes, with equations $y = 1$ and $x = 2$, as shown in Figure 1.

(a) In the space below, sketch the curve with equation $y = \mathrm{f}(x-1)$ and state the equations of the asymptotes of this curve.

(3)

(b) Find the coordinates of the points where the curve with equation $y = \mathrm{f}(x-1)$ crosses the coordinate axes.

(4)

Leave blank

Question 5 continued

Q5

(Total 7 marks)

Leave blank

6. An arithmetic sequence has first term a and common difference d. The sum of the first 10 terms of the sequence is 162.

(a) Show that $10a + 45d = 162$

(2)

Given also that the sixth term of the sequence is 17,

(b) write down a second equation in a and d,

(1)

(c) find the value of a and the value of d.

(4)

Leave blank

7. The curve with equation $y = \mathrm{f}(x)$ passes through the point $(-1, 0)$.

Given that

$$\mathrm{f}'(x) = 12x^2 - 8x + 1$$

find $\mathrm{f}(x)$.

(5)

H 3 5 4 0 2 A 0 1 2 2 4

Leave blank

8. The equation $x^2 + (k-3)x + (3-2k) = 0$, where k is a constant, has two distinct real roots.

(a) Show that k satisfies

$$k^2 + 2k - 3 > 0$$

(3)

(b) Find the set of possible values of k.

(4)

Leave blank

9. The line L_1 has equation $2y - 3x - k = 0$, where k is a constant.

Given that the point A $(1, 4)$ lies on L_1, find

(a) the value of k,

(1)

(b) the gradient of L_1.

(2)

The line L_2 passes through A and is perpendicular to L_1.

(c) Find an equation of L_2 giving your answer in the form $ax + by + c = 0$, where a, b and c are integers.

(4)

The line L_2 crosses the x-axis at the point B.

(d) Find the coordinates of B.

(2)

(e) Find the exact length of AB.

(2)

Leave blank

Question 9 continued

Leave blank

10. (a) On the axes below, sketch the graphs of

(i) $y = x(x+2)(3-x)$

(ii) $y = -\dfrac{2}{x}$

showing clearly the coordinates of all the points where the curves cross the coordinate axes.

(6)

(b) Using your sketch state, giving a reason, the number of real solutions to the equation

$$x(x+2)(3-x) + \frac{2}{x} = 0$$

(2)

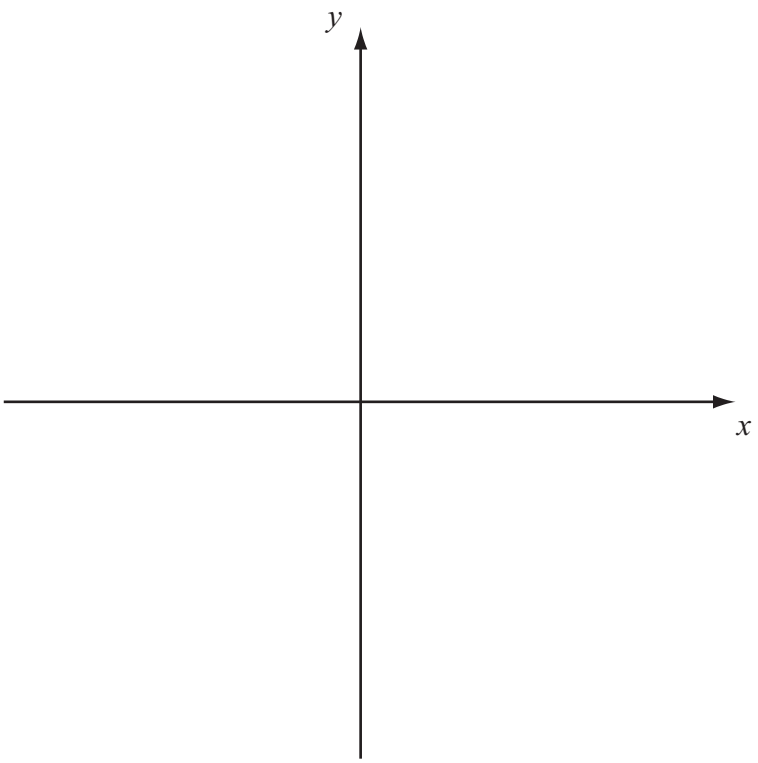

H 3 5 4 0 2 A 0 2 0 2 4

Leave blank

11. The curve C has equation

$$y = \frac{1}{2}x^3 - 9x^{\frac{3}{2}} + \frac{8}{x} + 30, \qquad x > 0$$

(a) Find $\frac{dy}{dx}$.

(4)

(b) Show that the point $P(4, -8)$ lies on C.

(2)

(c) Find an equation of the normal to C at the point P, giving your answer in the form $ax + by + c = 0$, where a, b and c are integers.

(6)

Leave blank

Question 11 continued

Q11

(Total 12 marks)

TOTAL FOR PAPER: 75 MARKS

END

physicsandmathstutor.com

Centre No.						Paper Reference							Surname	Initial(s)
Candidate No.						6	6	6	3	/	0	1	Signature	

Paper Reference(s)

6663/01

Edexcel GCE

Core Mathematics C1

Advanced Subsidiary

Wednesday 18 May 2011 – Morning

Time: 1 hour 30 minutes

Examiner's use only

Team Leader's use only

Question Number	Leave Blank
1	
2	
3	
4	
5	
6	
7	
8	
9	
10	
Total	

Materials required for examination
Mathematical Formulae (Pink)

Items included with question papers
Nil

Calculators may NOT be used in this examination.

Instructions to Candidates

In the boxes above, write your centre number, candidate number, your surname, initials and signature.
Check that you have the correct question paper.
Answer ALL the questions.
You must write your answer for each question in the space following the question.

Information for Candidates

A booklet 'Mathematical Formulae and Statistical Tables' is provided.
Full marks may be obtained for answers to ALL questions.
The marks for individual questions and the parts of questions are shown in round brackets: e.g. **(2)**.
There are 10 questions in this question paper. The total mark for this paper is 75.
There are 28 pages in this question paper. Any blank pages are indicated.

Advice to Candidates

You must ensure that your answers to parts of questions are clearly labelled.
You should show sufficient working to make your methods clear to the Examiner.
Answers without working may not gain full credit.

This publication may be reproduced only in accordance with
Edexcel Limited copyright policy.
©2011 Edexcel Limited.

Printer's Log. No.
P38157A
W850/R6663/57570 5/5/3

P 3 8 1 5 7 A 0 1 2 8

Turn over

edexcel
advancing learning, changing lives

Leave blank

1. Find the value of

(a) $25^{\frac{1}{2}}$

(1)

(b) $25^{-\frac{3}{2}}$

(2)

Q1

(Total 3 marks)

Leave blank

2. Given that $y = 2x^5 + 7 + \frac{1}{x^3}$, $x \neq 0$, find, in their simplest form,

(a) $\frac{dy}{dx}$,

(3)

(b) $\int y \, dx$.

(4)

Leave blank

3. The points P and Q have coordinates $(-1, 6)$ and $(9, 0)$ respectively.

The line l is perpendicular to PQ and passes through the mid-point of PQ.

Find an equation for l, giving your answer in the form $ax + by + c = 0$, where a, b and c are integers.

(5)

Leave blank

4. Solve the simultaneous equations

$$x + y = 2$$
$$4y^2 - x^2 = 11$$

(7)

Leave blank

5. A sequence $a_1, a_2, a_3, \ldots$ is defined by

$$a_1 = k,$$
$$a_{n+1} = 5a_n + 3, \qquad n \geqslant 1,$$

where k is a positive integer.

(a) Write down an expression for a_2 in terms of k.

(1)

(b) Show that $a_3 = 25k + 18$.

(2)

(c) (i) Find $\sum_{r=1}^{4} a_r$ in terms of k, in its simplest form.

(ii) Show that $\sum_{r=1}^{4} a_r$ is divisible by 6.

(4)

P 3 8 1 5 7 A 0 1 0 2 8

Leave blank

6. Given that $\dfrac{6x+3x^{\frac{5}{2}}}{\sqrt{x}}$ can be written in the form $6x^p + 3x^q$,

(a) write down the value of p and the value of q.

(2)

Given that $\dfrac{dy}{dx} = \dfrac{6x+3x^{\frac{5}{2}}}{\sqrt{x}}$, and that $y = 90$ when $x = 4$,

(b) find y in terms of x, simplifying the coefficient of each term.

(5)

Leave blank

7. $$\mathrm{f}(x) = x^2 + (k+3)x + k$$

where k is a real constant.

(a) Find the discriminant of $\mathrm{f}(x)$ in terms of k.

(2)

(b) Show that the discriminant of $\mathrm{f}(x)$ can be expressed in the form $(k+a)^2 + b$, where a and b are integers to be found.

(2)

(c) Show that, for all values of k, the equation $\mathrm{f}(x) = 0$ has real roots.

(2)

Leave blank

8.

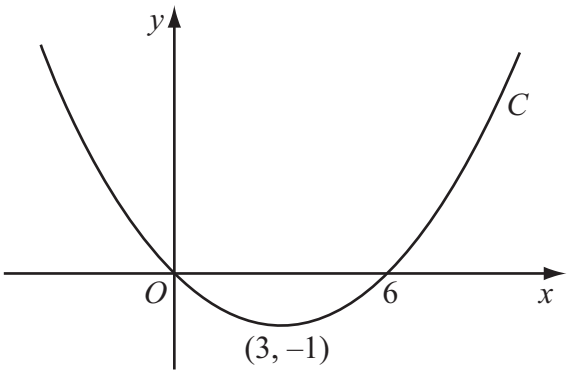

Figure 1

Figure 1 shows a sketch of the curve C with equation $y = \mathrm{f}(x)$.
The curve C passes through the origin and through $(6, 0)$.
The curve C has a minimum at the point $(3, -1)$.

On separate diagrams, sketch the curve with equation

(a) $y = \mathrm{f}(2x)$,

(3)

(b) $y = -\mathrm{f}(x)$,

(3)

(c) $y = \mathrm{f}(x + p)$, where p is a constant and $0 < p < 3$.

(4)

On each diagram show the coordinates of any points where the curve intersects the x-axis and of any minimum or maximum points.

Leave blank

Question 8 continued

Leave blank

9. (a) Calculate the sum of all the even numbers from 2 to 100 inclusive,

$$2 + 4 + 6 + \ldots\ldots + 100$$

(3)

(b) In the arithmetic series

$$k + 2k + 3k + \ldots\ldots + 100$$

k is a positive integer and k is a factor of 100.

(i) Find, in terms of k, an expression for the number of terms in this series.

(ii) Show that the sum of this series is

$$50 + \frac{5000}{k}$$

(4)

(c) Find, in terms of k, the 50th term of the arithmetic sequence

$$(2k + 1), (4k + 4), (6k + 7), \ldots\ldots ,$$

giving your answer in its simplest form.

(2)

Leave blank

Question 9 continued

Leave blank

10. The curve C has equation

$$y = (x+1)(x+3)^2$$

(a) Sketch C, showing the coordinates of the points at which C meets the axes.

(4)

(b) Show that $\frac{dy}{dx} = 3x^2 + 14x + 15$.

(3)

The point A, with x-coordinate -5, lies on C.

(c) Find the equation of the tangent to C at A, giving your answer in the form $y = mx + c$, where m and c are constants.

(4)

Another point B also lies on C. The tangents to C at A and B are parallel.

(d) Find the x-coordinate of B.

(3)

Leave blank

Question 10 continued

Q10

(Total 14 marks)

TOTAL FOR PAPER: 75 MARKS

END

P 3 8 1 5 7 A 0 2 8 2 8

physicsandmathstutor.com

Centre No.						Paper Reference							Surname	Initial(s)
Candidate No.						6	6	6	3	/	0	1	Signature	

Paper Reference(s)

6663/01

Edexcel GCE

Core Mathematics C1

Advanced Subsidiary

Friday 13 January 2012 – Morning

Time: 1 hour 30 minutes

Examiner's use only

Team Leader's use only

Question Number	Leave Blank
1	
2	
3	
4	
5	
6	
7	
8	
9	
10	
Total	

Materials required for examination
Mathematical Formulae (Pink)

Items included with question papers
Nil

Calculators may NOT be used in this examination.

Instructions to Candidates

In the boxes above, write your centre number, candidate number, your surname, initials and signature.
Check that you have the correct question paper.
Answer ALL the questions.
You must write your answer to each question in the space following the question.

Information for Candidates

A booklet 'Mathematical Formulae and Statistical Tables' is provided.
Full marks may be obtained for answers to ALL questions.
The marks for individual questions and the parts of questions are shown in round brackets: e.g. **(2)**.
There are 10 questions in this question paper. The total mark for this paper is 75.
There are 28 pages in this question paper. Any blank pages are indicated.

Advice to Candidates

You must ensure that your answers to parts of questions are clearly labelled.
You should show sufficient working to make your methods clear to the Examiner.
Answers without working may not gain full credit.

This publication may be reproduced only in accordance with
Pearson Education Ltd copyright policy.
©2012 Pearson Education Ltd.

Printer's Log. No.
P40082A
W850/R6663/57570 5/4/5/4

P 4 0 0 8 2 A 0 1 2 8

Turn over

PEARSON

Leave blank

1. Given that $y = x^4 + 6x^{\frac{1}{2}}$, find in their simplest form

(a) $\dfrac{dy}{dx}$

(3)

(b) $\int y \, dx$

(3)

P 4 0 0 8 2 A 0 2 2 8

Leave blank

2. (a) Simplify

$$\sqrt{32}+\sqrt{18}$$

giving your answer in the form $a\sqrt{2}$, where a is an integer.

(2)

(b) Simplify

$$\frac{\sqrt{32}+\sqrt{18}}{3+\sqrt{2}}$$

giving your answer in the form $b\sqrt{2}+c$, where b and c are integers.

(4)

Leave blank

3. Find the set of values of x for which

(a) $4x - 5 > 15 - x$

(2)

(b) $x(x - 4) > 12$

(4)

Leave blank

4. A sequence $x_1, x_2, x_3, \ldots$ is defined by

$$x_1 = 1$$

$$x_{n+1} = ax_n + 5, \qquad n \geqslant 1$$

where a is a constant.

(a) Write down an expression for x_2 in terms of a.

(1)

(b) Show that $x_3 = a^2 + 5a + 5$

(2)

Given that $x_3 = 41$

(c) find the possible values of a.

(3)

P 4 0 0 8 2 A 0 8 2 8

Leave blank

5. The curve C has equation $y = x(5 - x)$ and the line L has equation $2y = 5x + 4$

(a) Use algebra to show that C and L do not intersect.

(4)

(b) In the space on page 11, sketch C and L on the same diagram, showing the coordinates of the points at which C and L meet the axes.

(4)

Leave blank

6.

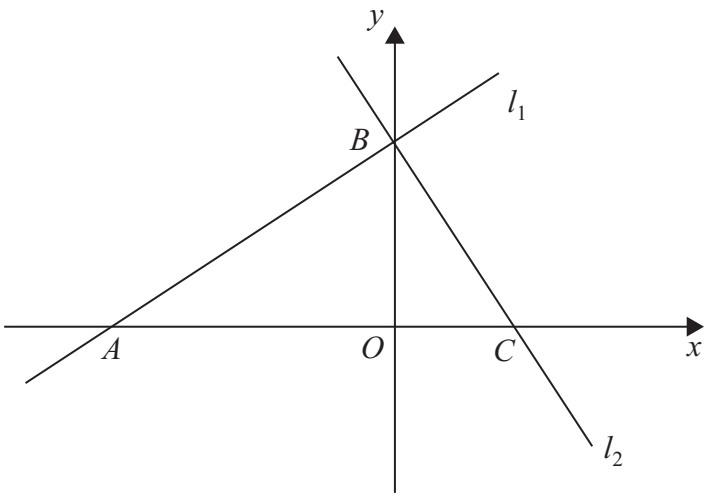

Figure 1

The line l_1 has equation $2x - 3y + 12 = 0$

(a) Find the gradient of l_1.

(1)

The line l_1 crosses the x-axis at the point A and the y-axis at the point B, as shown in Figure 1.

The line l_2 is perpendicular to l_1 and passes through B.

(b) Find an equation of l_2.

(3)

The line l_2 crosses the x-axis at the point C.

(c) Find the area of triangle ABC.

(4)

P 4 0 0 8 2 A 0 1 2 2 8

Leave blank

Question 6 continued

Leave blank

7. A curve with equation $y = \mathrm{f}(x)$ passes through the point (2, 10). Given that

$$\mathrm{f}'(x) = 3x^2 - 3x + 5$$

find the value of $\mathrm{f}(1)$.

(5)

P 4 0 0 8 2 A 0 1 6 2 8

Leave blank

8. The curve C_1 has equation

$$y = x^2(x+2)$$

(a) Find $\frac{dy}{dx}$

(2)

(b) Sketch C_1, showing the coordinates of the points where C_1 meets the x-axis.

(3)

(c) Find the gradient of C_1 at each point where C_1 meets the x-axis.

(2)

The curve C_2 has equation

$$y = (x-k)^2(x-k+2)$$

where k is a constant and $k > 2$

(d) Sketch C_2, showing the coordinates of the points where C_2 meets the x and y axes.

(3)

Leave blank

Question 8 continued

Leave blank

9. A company offers two salary schemes for a 10-year period, Year 1 to Year 10 inclusive.

Scheme 1: Salary in Year 1 is £P.
Salary increases by £($2T$) each year, forming an arithmetic sequence.

Scheme 2: Salary in Year 1 is £(P + 1800).
Salary increases by £T each year, forming an arithmetic sequence.

(a) Show that the **total** earned under Salary Scheme 1 for the 10-year period is

$$£(10P + 90T)$$

(2)

For the 10-year period, the **total** earned is the same for both salary schemes.

(b) Find the value of T.

(4)

For this value of T, the salary in Year 10 under Salary Scheme 2 is £29 850

(c) Find the value of P.

(3)

Leave blank

Question 9 continued

Leave blank

10.

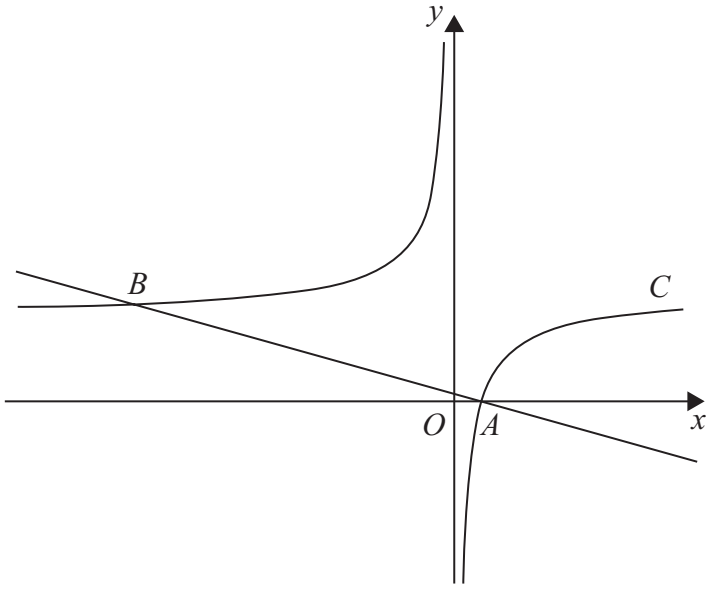

Figure 2

Figure 2 shows a sketch of the curve C with equation

$$y = 2 - \frac{1}{x}, \quad x \neq 0$$

The curve crosses the x-axis at the point A.

(a) Find the coordinates of A.

(1)

(b) Show that the equation of the normal to C at A can be written as

$$2x + 8y - 1 = 0$$

(6)

The normal to C at A meets C again at the point B, as shown in Figure 2.

(c) Find the coordinates of B.

(4)

Leave blank

Question 10 continued

Q10

(Total 11 marks)

TOTAL FOR PAPER: 75 MARKS

END

physicsandmathstutor.com

Centre No.						Paper Reference							Surname	Initial(s)
Candidate No.						6	6	6	3	/	0	1	Signature	

Paper Reference(s)

6663/01

Edexcel GCE

Core Mathematics C1

Advanced Subsidiary

Wednesday 16 May 2012 – Morning

Time: 1 hour 30 minutes

Examiner's use only

Team Leader's use only

Question Number	Leave Blank
1	
2	
3	
4	
5	
6	
7	
8	
9	
10	
Total	

Materials required for examination
Mathematical Formulae (Pink)

Items included with question papers
Nil

Calculators may NOT be used in this examination.

Instructions to Candidates

In the boxes above, write your centre number, candidate number, your surname, initials and signature.
Check that you have the correct question paper.
Answer ALL the questions.
You must write your answer for each question in the space following the question.

Information for Candidates

A booklet 'Mathematical Formulae and Statistical Tables' is provided.
Full marks may be obtained for answers to ALL questions.
The marks for individual questions and the parts of questions are shown in round brackets: e.g. **(2)**.
There are 10 questions in this question paper. The total mark for this paper is 75.
There are 24 pages in this question paper. Any blank pages are indicated.

Advice to Candidates

You must ensure that your answers to parts of questions are clearly labelled.
You should show sufficient working to make your methods clear to the Examiner.
Answers without working may not gain full credit.

This publication may be reproduced only in accordance with
Pearson Education Ltd copyright policy.
©2012 Pearson Education Ltd.

Printer's Log. No.
P40684A
W850/R6663/57570 5/5/5/5

P 4 0 6 8 4 A 0 1 2 4

Turn over

PEARSON

Leave blank

1. Find

$$\int \left(6x^2 + \frac{2}{x^2} + 5 \right) \mathrm{d}x$$

giving each term in its simplest form.

(4)

Q1

(Total 4 marks)

Leave blank

2. (a) Evaluate $(32)^{\frac{3}{5}}$, giving your answer as an integer.

(2)

(b) Simplify fully $\left(\frac{25x^4}{4}\right)^{-\frac{1}{2}}$

(2)

Q2

(Total 4 marks)

Leave blank

3. Show that $\dfrac{2}{\sqrt{(12)}-\sqrt{(8)}}$ can be written in the form $\sqrt{a}+\sqrt{b}$, where a and b are integers.

(5)

Leave blank

4. $$y = 5x^3 - 6x^{\frac{4}{3}} + 2x - 3$$

(a) Find $\frac{dy}{dx}$ giving each term in its simplest form. **(4)**

(b) Find $\frac{d^2y}{dx^2}$ **(2)**

Leave blank

5. A sequence of numbers $a_1, a_2, a_3 \ldots$ is defined by

$$a_1 = 3$$

$$a_{n+1} = 2a_n - c \qquad (n \geqslant 1)$$

where c is a constant.

(a) Write down an expression, in terms of c, for a_2

(1)

(b) Show that $a_3 = 12 - 3c$

(2)

Given that $\sum_{i=1}^{4} a_i \geqslant 23$

(c) find the range of values of c.

(4)

Leave blank

6. A boy saves some money over a period of 60 weeks. He saves 10p in week 1, 15p in week 2, 20p in week 3 and so on until week 60. His weekly savings form an arithmetic sequence.

(a) Find how much he saves in week 15

(2)

(b) Calculate the total amount he saves over the 60 week period.

(3)

The boy's sister also saves some money each week over a period of m weeks. She saves 10p in week 1, 20p in week 2, 30p in week 3 and so on so that her weekly savings form an arithmetic sequence. She saves a total of £63 in the m weeks.

(c) Show that

$$m(m + 1) = 35 \times 36$$

(4)

(d) Hence write down the value of m.

(1)

Leave blank

Question 6 continued

Leave blank

7. The point P (4, –1) lies on the curve C with equation $y = \mathrm{f}(x)$, $x > 0$, and

$$\mathrm{f}'(x) = \frac{1}{2}x - \frac{6}{\sqrt{x}} + 3$$

(a) Find the equation of the tangent to C at the point P, giving your answer in the form $y = mx + c$, where m and c are integers.

(4)

(b) Find $\mathrm{f}(x)$.

(4)

P 4 0 6 8 4 A 0 1 4 2 4

Leave blank

8. $$4x - 5 - x^2 = q - (x + p)^2$$

where p and q are integers.

(a) Find the value of p and the value of q.

(3)

(b) Calculate the discriminant of $4x - 5 - x^2$

(2)

(c) On the axes on page 17, sketch the curve with equation $y = 4x - 5 - x^2$ showing clearly the coordinates of any points where the curve crosses the coordinate axes.

(3)

Leave blank

Question 8 continued

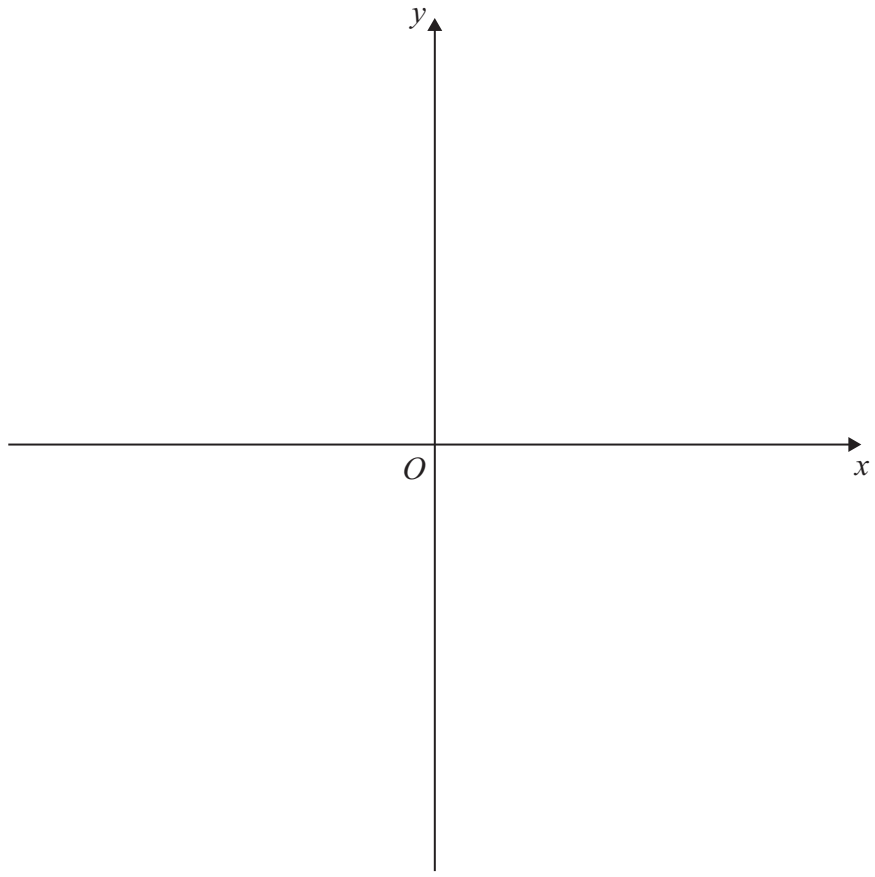

Q8

(Total 8 marks)

Leave blank

9. The line L_1 has equation $4y + 3 = 2x$

The point A $(p, 4)$ lies on L_1

(a) Find the value of the constant p.

(1)

The line L_2 passes through the point C (2, 4) and is perpendicular to L_1

(b) Find an equation for L_2 giving your answer in the form $ax + by + c = 0$, where a, b and c are integers.

(5)

The line L_1 and the line L_2 intersect at the point D.

(c) Find the coordinates of the point D.

(3)

(d) Show that the length of CD is $\frac{3}{2}\sqrt{5}$

(3)

A point B lies on L_1 and the length of $AB = \sqrt{(80)}$

The point E lies on L_2 such that the length of the line $CDE = 3$ times the length of CD.

(e) Find the area of the quadrilateral $ACBE$.

(3)

Leave blank

Question 9 continued

Leave blank

10.

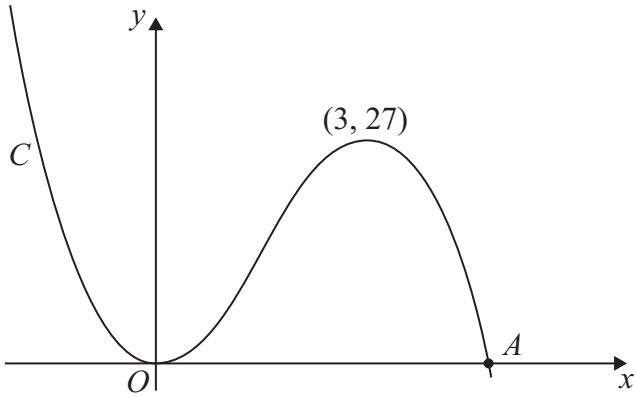

Figure 1

Figure 1 shows a sketch of the curve C with equation $y = \mathrm{f}(x)$ where

$$\mathrm{f}(x) = x^2(9 - 2x)$$

There is a minimum at the origin, a maximum at the point (3, 27) and C cuts the x-axis at the point A.

(a) Write down the coordinates of the point A.

(1)

(b) On separate diagrams sketch the curve with equation

(i) $y = \mathrm{f}(x + 3)$

(ii) $y = \mathrm{f}(3x)$

On each sketch you should indicate clearly the coordinates of the maximum point and any points where the curves cross or meet the coordinate axes.

(6)

The curve with equation $y = \mathrm{f}(x) + k$, where k is a constant, has a maximum point at (3, 10).

(c) Write down the value of k.

(1)

P 4 0 6 8 4 A 0 2 2 2 4

Leave blank

Question 10 continued

Q10

(Total 8 marks)

TOTAL FOR PAPER: 75 MARKS

END

physicsandmathstutor.com

Centre No.						Paper Reference							Surname	Initial(s)
Candidate No.						6	6	6	3	/	0	1	Signature	

Paper Reference(s)

6663/01

Edexcel GCE

Core Mathematics C1

Advanced Subsidiary

Monday 14 January 2013 – Morning

Time: 1 hour 30 minutes

Examiner's use only

Team Leader's use only

Question Number	Leave Blank
1	
2	
3	
4	
5	
6	
7	
8	
9	
10	
11	
Total	

Materials required for examination
Mathematical Formulae (Pink)

Items included with question papers
Nil

Calculators may NOT be used in this examination.

Instructions to Candidates

In the boxes above, write your centre number, candidate number, your surname, initials and signature.
Check that you have the correct question paper.
Answer ALL the questions.
You must write your answer for each question in the space following the question.

Information for Candidates

A booklet 'Mathematical Formulae and Statistical Tables' is provided.
Full marks may be obtained for answers to ALL questions.
The marks for individual questions and the parts of questions are shown in round brackets: e.g. **(2)**.
There are 11 questions in this question paper. The total mark for this paper is 75.
There are 32 pages in this question paper. Any blank pages are indicated.

Advice to Candidates

You must ensure that your answers to parts of questions are clearly labelled.
You should show sufficient working to make your methods clear to the Examiner.
Answers without working may not gain full credit.

This publication may be reproduced only in accordance with
Pearson Education Ltd copyright policy.
©2013 Pearson Education Ltd.

Printer's Log. No.
P41488A
W850/R6663/57570 4/5/5/5/

P 4 1 4 8 8 A 0 1 3 2

Turn over

PEARSON

Leave blank

1. Factorise completely $x - 4x^3$

(3)

Q1

(Total 3 marks)

Leave blank

2. Express 8^{2x+3} in the form 2^{y}, stating y in terms of x.

(2)

Q2

(Total 2 marks)

Leave blank

3. (i) Express

$$\left(5 - \sqrt{8}\right)\left(1 + \sqrt{2}\right)$$

in the form $a + b\sqrt{2}$, where a and b are integers.

(3)

(ii) Express

$$\sqrt{80} + \frac{30}{\sqrt{5}}$$

in the form $c\sqrt{5}$, where c is an integer.

(3)

Leave blank

4. A sequence $u_1, u_2, u_3, \ldots$ satisfies

$$u_{n+1} = 2u_n - 1, \quad n \geqslant 1$$

Given that $u_2 = 9$,

(a) find the value of u_3 and the value of u_4,

(2)

(b) evaluate $\sum_{r=1}^{4} u_r$.

(3)

P 4 1 4 8 8 A 0 6 3 2

Leave blank

5. The line l_1 has equation $y = -2x + 3$

The line l_2 is perpendicular to l_1 and passes through the point (5, 6).

(a) Find an equation for l_2 in the form $ax + by + c = 0$, where a, b and c are integers.
(3)

The line l_2 crosses the x-axis at the point A and the y-axis at the point B.

(b) Find the x-coordinate of A and the y-coordinate of B.
(2)

Given that O is the origin,

(c) find the area of the triangle OAB.
(2)

Leave blank

Question 5 continued

Leave blank

6.

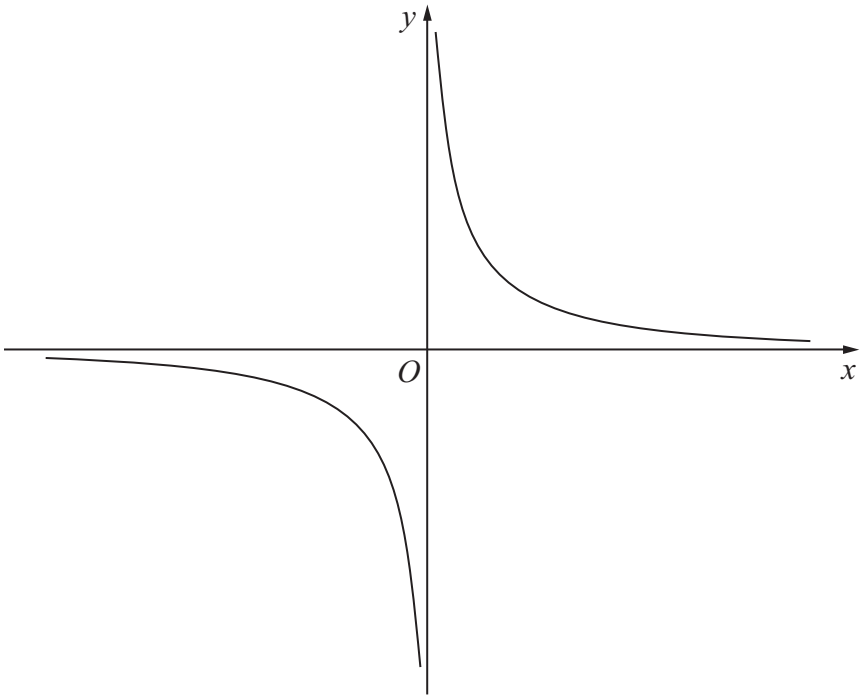

Figure 1

Figure 1 shows a sketch of the curve with equation $y = \frac{2}{x}$, $x \neq 0$

The curve C has equation $y = \frac{2}{x} - 5$, $x \neq 0$, and the line l has equation $y = 4x + 2$

(a) Sketch and clearly label the graphs of C and l on a single diagram.

On your diagram, show clearly the coordinates of the points where C and l cross the coordinate axes.

(5)

(b) Write down the equations of the asymptotes of the curve C.

(2)

(c) Find the coordinates of the points of intersection of $y = \frac{2}{x} - 5$ and $y = 4x + 2$

(5)

P 4 1 4 8 8 A 0 1 2 3 2

Leave blank

Question 6 continued

Leave blank

7. Lewis played a game of space invaders. He scored points for each spaceship that he captured.

Lewis scored 140 points for capturing his first spaceship.

He scored 160 points for capturing his second spaceship, 180 points for capturing his third spaceship, and so on.

The number of points scored for capturing each successive spaceship formed an arithmetic sequence.

(a) Find the number of points that Lewis scored for capturing his 20th spaceship.
(2)

(b) Find the total number of points Lewis scored for capturing his first 20 spaceships.
(3)

Sian played an adventure game. She scored points for each dragon that she captured. The number of points that Sian scored for capturing each successive dragon formed an arithmetic sequence.

Sian captured n dragons and the total number of points that she scored for capturing all n dragons was 8500.

Given that Sian scored 300 points for capturing her first dragon and then 700 points for capturing her nth dragon,

(c) find the value of n.
(3)

Leave blank

Question 7 continued

Leave blank

8. $$\frac{dy}{dx} = -x^3 + \frac{4x - 5}{2x^3}, \qquad x \neq 0$$

Given that $y = 7$ at $x = 1$, find y in terms of x, giving each term in its simplest form.

(6)

Leave blank

9. The equation

$$(k + 3)x^2 + 6x + k = 5, \text{ where } k \text{ is a constant,}$$

has two distinct real solutions for x.

(a) Show that k satisfies

$$k^2 - 2k - 24 < 0$$

(4)

(b) Hence find the set of possible values of k.

(3)

Leave blank

10. $$4x^2 + 8x + 3 \equiv a(x + b)^2 + c$$

(a) Find the values of the constants a, b and c.

(3)

(b) On the axes on page 27, sketch the curve with equation $y = 4x^2 + 8x + 3$, showing clearly the coordinates of any points where the curve crosses the coordinate axes.

(4)

Leave blank

Question 10 continued

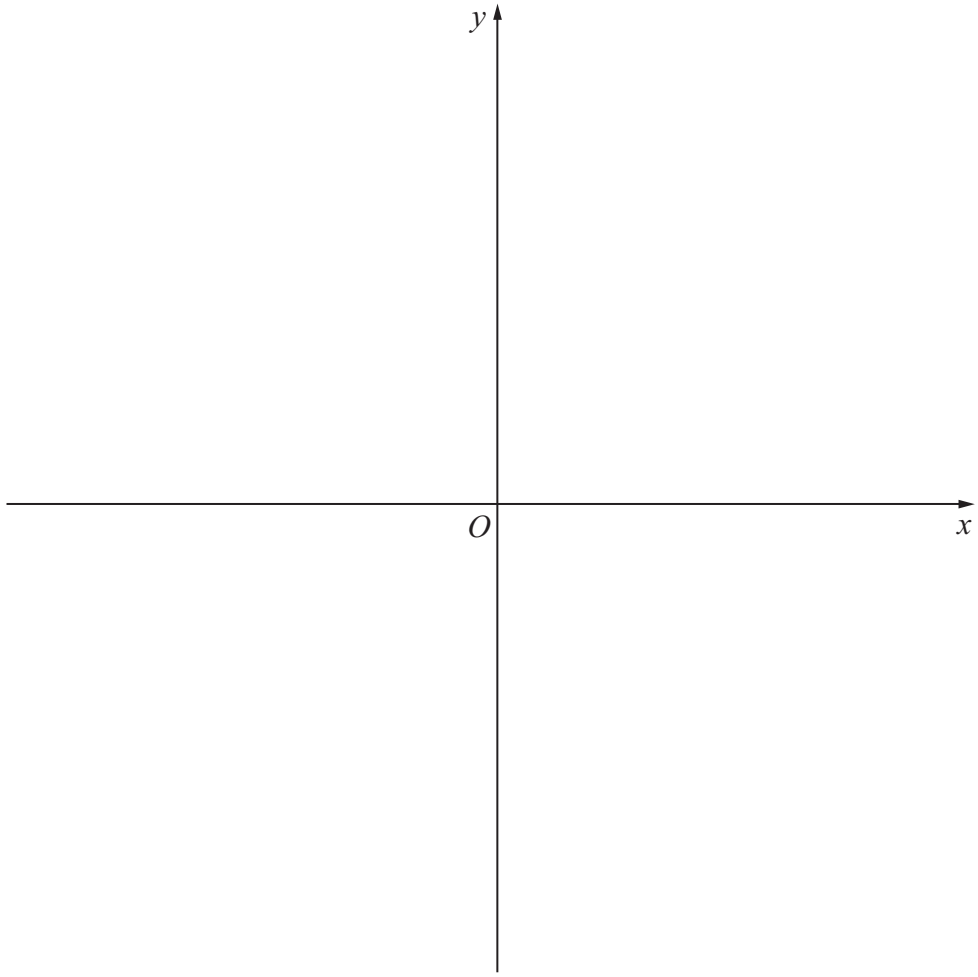

Leave blank

11. The curve C has equation

$$y = 2x - 8\sqrt{x} + 5, \quad x \geqslant 0$$

(a) Find $\frac{dy}{dx}$, giving each term in its simplest form.

(3)

The point P on C has x-coordinate equal to $\frac{1}{4}$

(b) Find the equation of the tangent to C at the point P, giving your answer in the form $y = ax + b$, where a and b are constants.

(4)

The tangent to C at the point Q is parallel to the line with equation $2x - 3y + 18 = 0$

(c) Find the coordinates of Q.

(5)

Leave blank

Question 11 continued

Q11

(Total 12 marks)

TOTAL FOR PAPER: 75 MARKS

END

physicsandmathstutor.com

Centre No.						Paper Reference							Surname	Initial(s)
Candidate No.						6	6	6	3	/	0	1 R	Signature	

Paper Reference(s)

6663/01R

Edexcel GCE

Core Mathematics C1

Advanced Subsidiary

Monday 13 May 2013 – Afternoon

Time: 1 hour 30 minutes

Examiner's use only

Team Leader's use only

Question Number	Leave Blank
1	
2	
3	
4	
5	
6	
7	
8	
9	
10	
11	
Total	

Materials required for examination
Mathematical Formulae (Pink)

Items included with question papers
Nil

Calculators may NOT be used in this examination.

Instructions to Candidates

In the boxes above, write your centre number, candidate number, your surname, initials and signature.
Check that you have the correct question paper.
Answer ALL the questions.
You must write your answer for each question in the space following the question.

Information for Candidates

A booklet 'Mathematical Formulae and Statistical Tables' is provided.
Full marks may be obtained for answers to ALL questions.
The marks for individual questions and the parts of questions are shown in round brackets: e.g. **(2)**.
There are 11 questions in this question paper. The total mark for this paper is 75.
There are 32 pages in this question paper. Any blank pages are indicated.

Advice to Candidates

You must ensure that your answers to parts of questions are clearly labelled.
You should show sufficient working to make your methods clear to the Examiner.
Answers without working may not gain full credit.

This publication may be reproduced only in accordance with
Pearson Education Ltd copyright policy.
©2013 Pearson Education Ltd.

Printer's Log. No.
P42823A
W850/R6663/57570 5/5/5/5/

P 4 2 8 2 3 A 0 1 3 2

Turn over

PEARSON

Leave blank

1. Given $y = x^3 + 4x + 1$, find the value of $\frac{dy}{dx}$ when $x = 3$

(4)

Q1

(Total 4 marks)

Leave blank

2. Express $\frac{15}{\sqrt{3}} - \sqrt{27}$ in the form $k\sqrt{3}$, where k is an integer.

(4)

Q2

(Total 4 marks)

Leave blank

3. Find

$$\int \left(3x^2 - \frac{4}{x^2}\right) \mathrm{d}x$$

giving each term in its simplest form.

(4)

Leave blank

4. The line L_1 has equation $4x + 2y - 3 = 0$

(a) Find the gradient of L_1.

(2)

The line L_2 is perpendicular to L_1 and passes through the point (2, 5).

(b) Find the equation of L_2 in the form $y = mx + c$, where m and c are constants.

(3)

Leave blank

5. Solve

(a) $2^y = 8$

(1)

(b) $2^x \times 4^{x+1} = 8$

(4)

Leave blank

6. A sequence $x_1, x_2, x_3 \ldots$ is defined by

$$x_1 = 1$$

$$x_{n+1} = (x_n)^2 - kx_n, \quad n \geqslant 1$$

where k is a constant, $k \neq 0$

(a) Find an expression for x_2 in terms of k.

(1)

(b) Show that $x_3 = 1 - 3k + 2k^2$

(2)

Given also that $x_3 = 1$,

(c) calculate the value of k.

(3)

(d) Hence find the value of $\sum_{n=1}^{100} x_n$

(3)

P 4 2 8 2 3 A 0 1 0 3 2

Leave blank

Question 6 continued

Leave blank

7. Each year, Abbie pays into a savings scheme. In the first year she pays in £500. Her payments then increase by £200 each year so that she pays £700 in the second year, £900 in the third year and so on.

(a) Find out how much Abbie pays into the savings scheme in the tenth year.

(2)

Abbie pays into the scheme for n years until she has paid in a total of £67200.

(b) Show that $n^2 + 4n - 24 \times 28 = 0$

(5)

(c) Hence find the number of years that Abbie pays into the savings scheme.

(2)

Leave blank

Question 7 continued

Leave blank

8. A rectangular room has a width of x m.

The length of the room is 4 m longer than its width.

Given that the perimeter of the room is greater than 19.2 m,

(a) show that $x > 2.8$

(3)

Given also that the area of the room is less than 21 m^2,

(b) (i) write down an inequality, in terms of x, for the area of the room.

(ii) Solve this inequality.

(4)

(c) Hence find the range of possible values for x.

(1)

Leave blank

Question 8 continued

Leave blank

9.

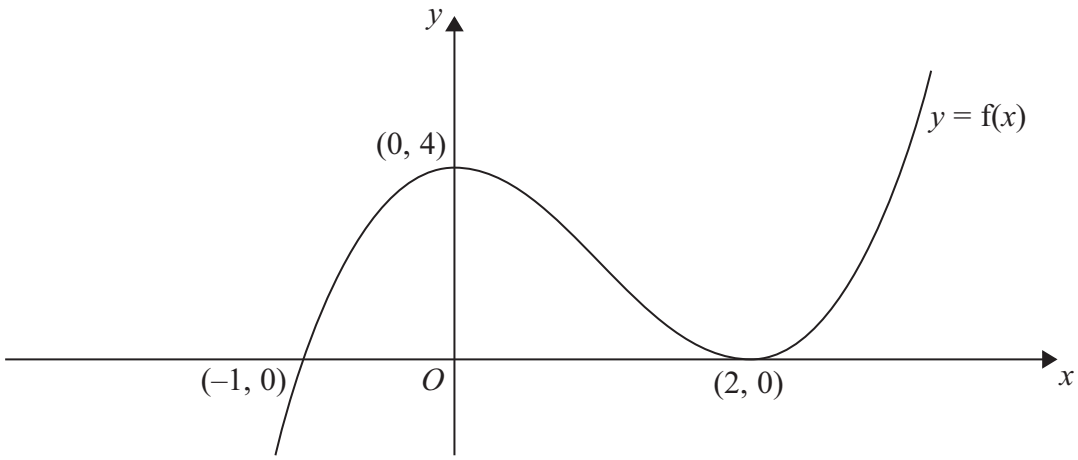

Figure 1

Figure 1 shows a sketch of the curve C with equation $y = \mathrm{f}(x)$.

The curve C passes through the point $(-1, 0)$ and touches the x-axis at the point $(2, 0)$.

The curve C has a maximum at the point $(0, 4)$.

(a) The equation of the curve C can be written in the form

$$y = x^3 + ax^2 + bx + c$$

where a, b and c are integers.

Calculate the values of a, b and c.

(5)

(b) Sketch the curve with equation $y = \mathrm{f}(\frac{1}{2}x)$ in the space provided on page 24

Show clearly the coordinates of all the points where the curve crosses or meets the coordinate axes.

(3)

Leave blank

Question 9 continued

Leave blank

10. A curve has equation $y = \mathrm{f}(x)$. The point P with coordinates (9, 0) lies on the curve.

Given that

$$\mathrm{f}'(x) = \frac{x+9}{\sqrt{x}}, \qquad x > 0$$

(a) find $\mathrm{f}(x)$.

(6)

(b) Find the x-coordinates of the two points on $y = \mathrm{f}(x)$ where the gradient of the curve is equal to 10

(4)

Leave blank

11.

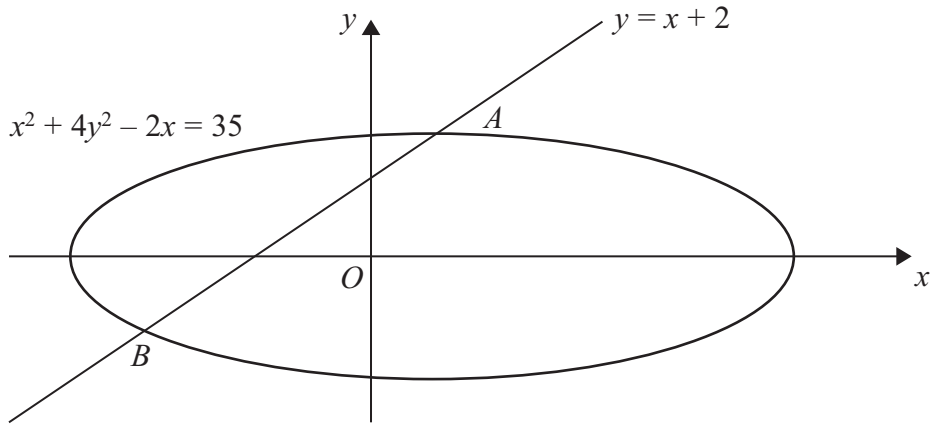

Figure 2

The line $y = x + 2$ meets the curve $x^2 + 4y^2 - 2x = 35$ at the points A and B as shown in Figure 2.

(a) Find the coordinates of A and the coordinates of B.

(6)

(b) Find the distance AB in the form $r\sqrt{2}$ where r is a rational number.

(3)

P 4 2 8 2 3 A 0 3 0 3 2

Leave blank

Question 11 continued

Q11

(Total 9 marks)

TOTAL FOR PAPER: 75 MARKS

END

physicsandmathstutor.com

Centre No.						Paper Reference							Surname	Initial(s)
Candidate No.						6	6	6	3	/	0	1	Signature	

Paper Reference(s)

6663/01

Edexcel GCE

Core Mathematics C1

Advanced Subsidiary

Monday 13 May 2013 – Afternoon

Time: 1 hour 30 minutes

Examiner's use only

Team Leader's use only

Question Number	Leave Blank
1	
2	
3	
4	
5	
6	
7	
8	
9	
10	
11	
Total	

Materials required for examination
Mathematical Formulae (Pink)

Items included with question papers
Nil

Calculators may NOT be used in this examination.

Instructions to Candidates

In the boxes above, write your centre number, candidate number, your surname, initials and signature.
Check that you have the correct question paper.
Answer ALL the questions.
You must write your answer for each question in the space following the question.

Information for Candidates

A booklet 'Mathematical Formulae and Statistical Tables' is provided.
Full marks may be obtained for answers to ALL questions.
The marks for individual questions and the parts of questions are shown in round brackets: e.g. **(2)**.
There are 11 questions in this question paper. The total mark for this paper is 75.
There are 28 pages in this question paper. Any blank pages are indicated.

Advice to Candidates

You must ensure that your answers to parts of questions are clearly labelled.
You should show sufficient working to make your methods clear to the Examiner.
Answers without working may not gain full credit.

This publication may be reproduced only in accordance with
Pearson Education Ltd copyright policy.
©2013 Pearson Education Ltd.

Printer's Log. No.
P41802A
W850/R6663/57570 5/5/5/5/6/

P 4 1 8 0 2 A 0 1 2 8

Turn over

PEARSON

Leave blank

1. Simplify

$$\frac{7 + \sqrt{5}}{\sqrt{5} - 1}$$

giving your answer in the form $a + b\sqrt{5}$, where a and b are integers.

(4)

Q1

(Total 4 marks)

Leave blank

2. Find

$$\int \left(10x^4 - 4x - \frac{3}{\sqrt{x}}\right) \mathrm{d}x$$

giving each term in its simplest form.

(4)

Q2

(Total 4 marks)

Leave blank

3. (a) Find the value of $8^{\frac{5}{3}}$

(2)

(b) Simplify fully $\dfrac{\left(2x^{\frac{1}{2}}\right)^3}{4x^2}$

(3)

P 4 1 8 0 2 A 0 4 2 8

Leave blank

4. A sequence $a_1, a_2, a_3, \ldots$ is defined by

$$a_1 = 4$$
$$a_{n+1} = k(a_n + 2), \qquad \text{for } n \geqslant 1$$

where k is a constant.

(a) Find an expression for a_2 in terms of k.

(1)

Given that $\sum_{i=1}^{3} a_i = 2$,

(b) find the two possible values of k.

(6)

P 4 1 8 0 2 A 0 6 2 8

Leave blank

5. Find the set of values of x for which

(a) $2(3x + 4) > 1 - x$

(2)

(b) $3x^2 + 8x - 3 < 0$

(4)

P 4 1 8 0 2 A 0 8 2 8

Leave blank

6. The straight line L_1 passes through the points $(-1, 3)$ and $(11, 12)$.

(a) Find an equation for L_1 in the form $ax + by + c = 0$,

where a, b and c are integers.

(4)

The line L_2 has equation $3y + 4x - 30 = 0$.

(b) Find the coordinates of the point of intersection of L_1 and L_2.

(3)

Leave blank

7. A company, which is making 200 mobile phones each week, plans to increase its production.

The number of mobile phones produced is to be increased by 20 each week from 200 in week 1 to 220 in week 2, to 240 in week 3 and so on, until it is producing 600 in week N.

(a) Find the value of N.

(2)

The company then plans to continue to make 600 mobile phones each week.

(b) Find the total number of mobile phones that will be made in the first 52 weeks starting from and including week 1.

(5)

Leave blank

8.

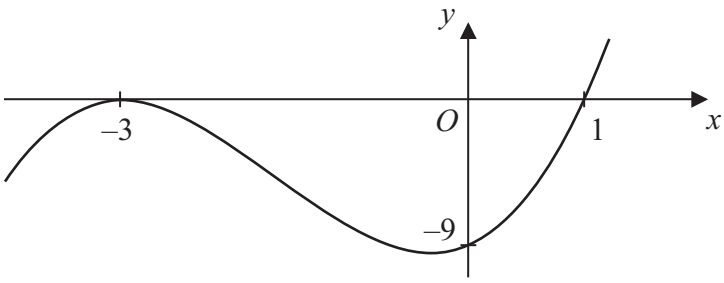

Figure 1

Figure 1 shows a sketch of the curve with equation $y = \mathrm{f}(x)$ where

$$\mathrm{f}(x) = (x + 3)^2 (x - 1), \qquad x \in \mathbb{R}.$$

The curve crosses the x-axis at $(1, 0)$, touches it at $(-3, 0)$ and crosses the y-axis at $(0, -9)$

(a) In the space below, sketch the curve C with equation $y = \mathrm{f}(x + 2)$ and state the coordinates of the points where the curve C meets the x-axis.

(3)

(b) Write down an equation of the curve C.

(1)

(c) Use your answer to part (b) to find the coordinates of the point where the curve C meets the y-axis.

(2)

Leave blank

Question 8 continued

Leave blank

9.

$$f'(x) = \frac{(3 - x^2)^2}{x^2}, \quad x \neq 0$$

(a) Show that $f'(x) = 9x^{-2} + A + Bx^2$,

where A and B are constants to be found.

(3)

(b) Find $f''(x)$.

(2)

Given that the point (–3, 10) lies on the curve with equation $y = f(x)$,

(c) find $f(x)$.

(5)

Leave blank

Question 9 continued

Q9

(Total 10 marks)

Leave blank

10. Given the simultaneous equations

$$2x + y = 1$$
$$x^2 - 4ky + 5k = 0$$

where k is a non zero constant,

(a) show that

$$x^2 + 8kx + k = 0$$

(2)

Given that $x^2 + 8kx + k = 0$ has equal roots,

(b) find the value of k.

(3)

(c) For this value of k, find the solution of the simultaneous equations.

(3)

Leave blank

Question 10 continued

Leave blank

11.

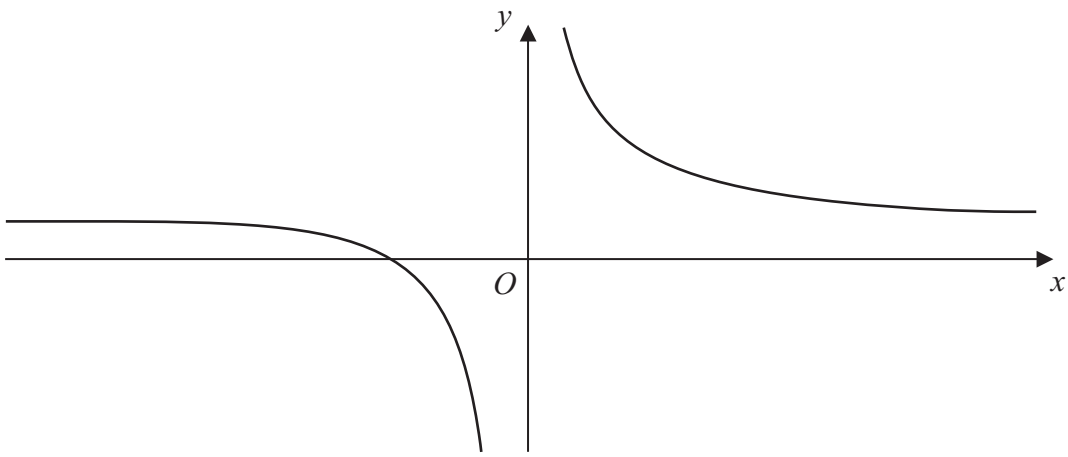

Figure 2

Figure 2 shows a sketch of the curve H with equation $y = \frac{3}{x} + 4$, $x \neq 0$.

(a) Give the coordinates of the point where H crosses the x-axis.

(1)

(b) Give the equations of the asymptotes to H.

(2)

(c) Find an equation for the normal to H at the point $P(-3, 3)$.

(5)

This normal crosses the x-axis at A and the y-axis at B.

(d) Find the length of the line segment AB. Give your answer as a surd.

(3)

P 4 1 8 0 2 A 0 2 4 2 8

Leave blank

Question 11 continued

Q11

(Total 11 marks)

TOTAL FOR PAPER: 75 MARKS

END

Write your name here

Surname	Other names

Pearson Edexcel International Advanced Level

Centre Number | Candidate Number

Core Mathematics C1

Advanced Subsidiary

Monday 13 January 2014 – Morning
Time: 1 hour 30 minutes

Paper Reference
6663A/01

You must have:
Mathematical Formulae and Statistical Tables (Pink)

Total Marks

Calculators may NOT be used in this examination.

Instructions

- Use **black** ink or ball-point pen.
- If pencil is used for diagrams/sketches/graphs it must be dark (HB or B). Coloured pencils and highlighter pens must not be used.
- **Fill in the boxes** at the top of this page with your name, centre number and candidate number.
- Answer **all** questions and ensure that your answers to parts of questions are clearly labelled.
- Answer the questions in the spaces provided – *there may be more space than you need.*
- You should show sufficient working to make your methods clear. Answers without working may not gain full credit.

Information

- The total mark for this paper is 75.
- The marks for **each** question are shown in brackets – *use this as a guide as to how much time to spend on each question.*

Advice

- Read each question carefully before you start to answer it.
- Try to answer every question.
- Check your answers if you have time at the end.

Turn over

©2014 Pearson Education Ltd.
5/5/5/5/

PEARSON

Leave blank

1. Simplify fully

(a) $(2\sqrt{x})^2$

(1)

(b) $\dfrac{5+\sqrt{7}}{2+\sqrt{7}}$

(3)

Leave blank

Question 1 continued

Q1

(Total 4 marks)

Leave blank

2. $$y = 2x^2 - \frac{4}{\sqrt{x}} + 1, \qquad x > 0$$

(a) Find $\frac{dy}{dx}$, giving each term in its simplest form. **(3)**

(b) Find $\frac{d^2y}{dx^2}$, giving each term in its simplest form. **(2)**

Leave blank

Question 2 continued

Q2

(Total 5 marks)

Leave blank

3. Solve the simultaneous equations

$$x - 2y - 1 = 0$$

$$x^2 + 4y^2 - 10x + 9 = 0$$

(7)

Leave blank

Question 3 continued

Q3

(Total 7 marks)

Leave blank

4.

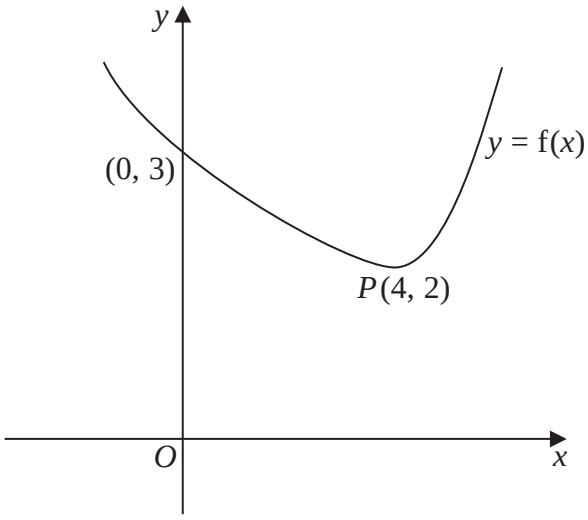

Figure 1

Figure 1 shows a sketch of a curve with equation $y = \mathrm{f}(x)$.

The curve crosses the y-axis at (0, 3) and has a minimum at P (4, 2).

On separate diagrams, sketch the curve with equation

(a) $y = \mathrm{f}(x + 4)$,

(2)

(b) $y = 2\mathrm{f}(x)$.

(2)

On each diagram, show clearly the coordinates of the minimum point and any point of intersection with the y-axis.

P 4 3 1 3 4 A 0 8 2 8

Leave blank

Question 4 continued

Q4

(Total 4 marks)

Leave blank

5. Given that for all positive integers n,

$$\sum_{r=1}^{n} a_r = 12 + 4n^2$$

(a) find the value of $\sum_{r=1}^{5} a_r$

(2)

(b) Find the value of a_6

(3)

Leave blank

Question 5 continued

Q5

(Total 5 marks)

Leave blank

6.

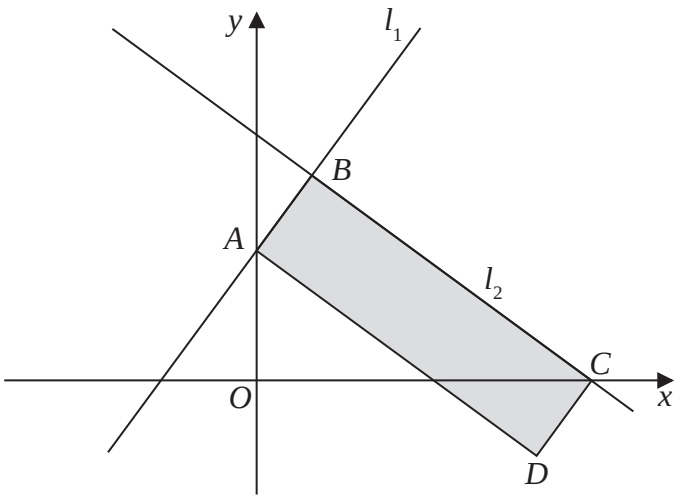

Figure 2

The straight line l_1 has equation $2y = 3x + 7$

The line l_1 crosses the y-axis at the point A as shown in Figure 2.

(a) (i) State the gradient of l_1

(ii) Write down the coordinates of the point A.

(2)

Another straight line l_2 intersects l_1 at the point B (1, 5) and crosses the x-axis at the point C, as shown in Figure 2.

Given that $\angle ABC = 90°$,

(b) find an equation of l_2 in the form $ax + by + c = 0$, where a, b and c are integers.

(4)

The rectangle $ABCD$, shown shaded in Figure 2, has vertices at the points A, B, C and D.

(c) Find the exact area of rectangle $ABCD$.

(5)

P 4 3 1 3 4 A 0 1 2 2 8

Leave blank

Question 6 continued

Leave blank

Question 6 continued

Leave blank

Question 6 continued

Q6

(Total 11 marks)

Leave blank

7. Shelim starts his new job on a salary of £14 000. He will receive a rise of £1500 a year for each full year that he works, so that he will have a salary of £15 500 in year 2, a salary of £17 000 in year 3 and so on. When Shelim's salary reaches £26 000, he will receive no more rises. His salary will remain at £26 000.

(a) Show that Shelim will have a salary of £26 000 in year 9.

(2)

(b) Find the total amount that Shelim will earn in his job in the first 9 years.

(2)

Anna starts her new job at the same time as Shelim on a salary of £A. She receives a rise of £1000 a year for each full year that she works, so that she has a salary of £(A + 1000) in year 2, £(A + 2000) in year 3 and so on. The maximum salary for her job, which is reached in year 10, is also £26 000.

(c) Find the difference in the total amount earned by Shelim and Anna in the first 10 years.

(6)

Leave blank

Question 7 continued

Leave blank

Question 7 continued

Leave blank

Question 7 continued

Q7

(Total 10 marks)

Leave blank

8. The equation $2x^2 + 2kx + (k + 2) = 0$, where k is a constant, has two distinct real roots.

(a) Show that k satisfies

$$k^2 - 2k - 4 > 0$$

(3)

(b) Find the set of possible values of k.

(4)

Leave blank

Question 8 continued

Q8

(Total 7 marks)

Leave blank

9. A curve with equation $y = \mathrm{f}(x)$ passes through the point (3, 6). Given that

$$\mathrm{f}'(x) = (x - 2)(3x + 4)$$

(a) use integration to find $\mathrm{f}(x)$. Give your answer as a polynomial in its simplest form.
(5)

(b) Show that $\mathrm{f}(x) \equiv (x - 2)^2(x + p)$, where p is a positive constant. State the value of p.
(3)

(c) Sketch the graph of $y = \mathrm{f}(x)$, showing the coordinates of any points where the curve touches or crosses the coordinate axes.
(4)

Leave blank

Question 9 continued

Leave blank

Question 9 continued

Leave blank

Question 9 continued

Q9

(Total 12 marks)

Leave blank

10. The curve C has equation $y = x^3 - 2x^2 - x + 3$

The point P, which lies on C, has coordinates (2, 1).

(a) Show that an equation of the tangent to C at the point P is $y = 3x - 5$

(5)

The point Q also lies on C.

Given that the tangent to C at Q is parallel to the tangent to C at P,

(b) find the coordinates of the point Q.

(5)

Leave blank

Question 10 continued

Leave blank

Question 10 continued

Q10

(Total 10 marks)

TOTAL FOR PAPER: 75 MARKS

END

Centre No.						Paper Reference							Surname	Initial(s)
Candidate No.						6	6	6	3	/	0	1R	Signature	

Paper Reference(s)

6663/01R

Edexcel GCE

Core Mathematics C1

Advanced Subsidiary

Monday 19 May 2014 – Morning

Time: 1 hour 30 minutes

Examiner's use only

Team Leader's use only

Question Number	Leave Blank
1	
2	
3	
4	
5	
6	
7	
8	
9	
10	
11	
Total	

Materials required for examination
Mathematical Formulae (Pink)

Items included with question papers
Nil

Calculators may NOT be used in this examination.

Instructions to Candidates

In the boxes above, write your centre number, candidate number, your surname, initials and signature.
Check that you have the correct question paper.
Answer ALL the questions.
You must write your answer for each question in the space following the question.

Information for Candidates

A booklet 'Mathematical Formulae and Statistical Tables' is provided.
Full marks may be obtained for answers to ALL questions.
The marks for individual questions and the parts of questions are shown in round brackets: e.g. **(2)**.
There are 11 questions in this question paper. The total mark for this paper is 75.
There are 32 pages in this question paper. Any blank pages are indicated.

Advice to Candidates

You must ensure that your answers to parts of questions are clearly labelled.
You should show sufficient working to make your methods clear to the Examiner.
Answers without working may not gain full credit.

This publication may be reproduced only in accordance with Pearson Education Ltd copyright policy.
©2014 Pearson Education Ltd.

Printer's Log. No.
P43146A
W850/R6663/57570 5/5/5/5/5/

P 4 3 1 4 6 A 0 1 3 2

Turn over

PEARSON

Leave blank

1. Factorise fully $25x - 9x^3$

(3)

Q1

(Total 3 marks)

P 4 3 1 4 6 A 0 2 3 2

Leave blank

2. (a) Evaluate $81^{\frac{3}{2}}$

(2)

(b) Simplify fully $x^2\left(4x^{-\frac{1}{2}}\right)^2$

(2)

Q2

(Total 4 marks)

Leave blank

3. A sequence $a_1, a_2, a_3, \ldots$ is defined by

$$a_{n+1} = 4a_n - 3, \qquad n \geqslant 1$$

$$a_1 = k, \qquad \text{where } k \text{ is a positive integer.}$$

(a) Write down an expression for a_2 in terms of k.

(1)

Given that $\sum_{r=1}^{3} a_r = 66$

(b) find the value of k.

(4)

P 4 3 1 4 6 A 0 4 3 2

Leave blank

Question 3 continued

Q3

(Total 5 marks)

Leave blank

4. Given that $y = 2x^5 + \frac{6}{\sqrt{x}}$, $x > 0$, find in their simplest form

(a) $\frac{dy}{dx}$

(3)

(b) $\int y \, dx$

(3)

Leave blank

5. Solve the equation

$$10 + x\sqrt{8} = \frac{6x}{\sqrt{2}}$$

Give your answer in the form $a\sqrt{b}$ where a and b are integers.

(4)

Leave blank

6.

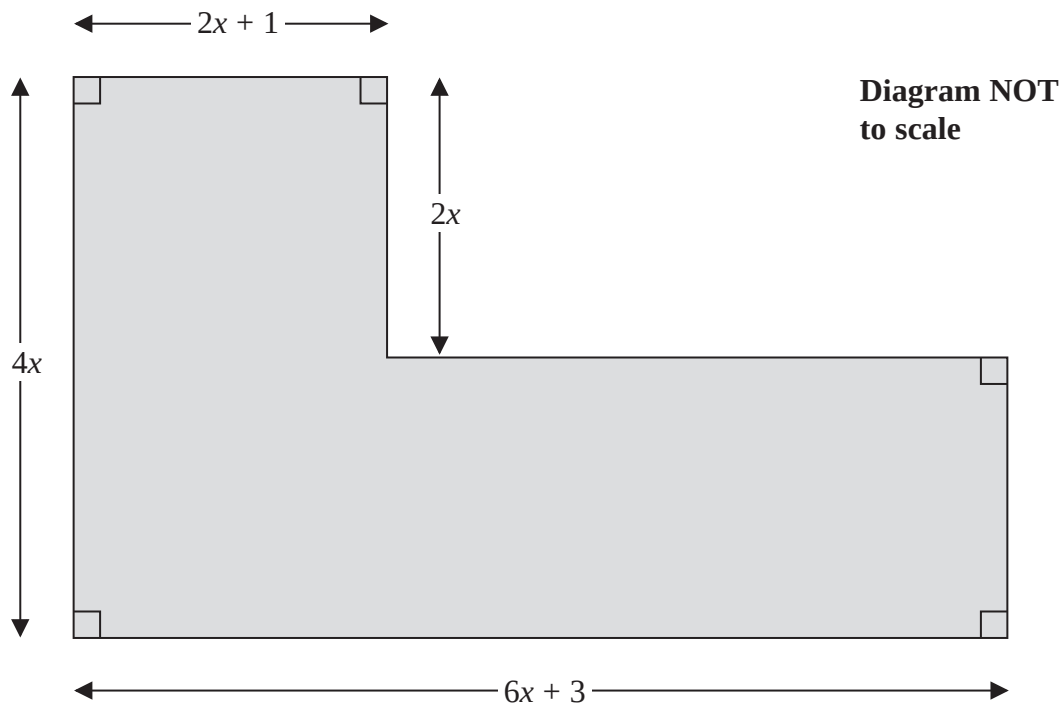

Figure 1

Figure 1 shows the plan of a garden. The marked angles are right angles.

The six edges are straight lines.

The lengths shown in the diagram are given in metres.

Given that the perimeter of the garden is greater than 40 m,

(a) show that $x > 1.7$

(3)

Given that the area of the garden is less than 120 m^2,

(b) form and solve a quadratic inequality in x.

(5)

(c) Hence state the range of the possible values of x.

(1)

P 4 3 1 4 6 A 0 1 0 3 2

Leave blank

Question 6 continued

Leave blank

7.

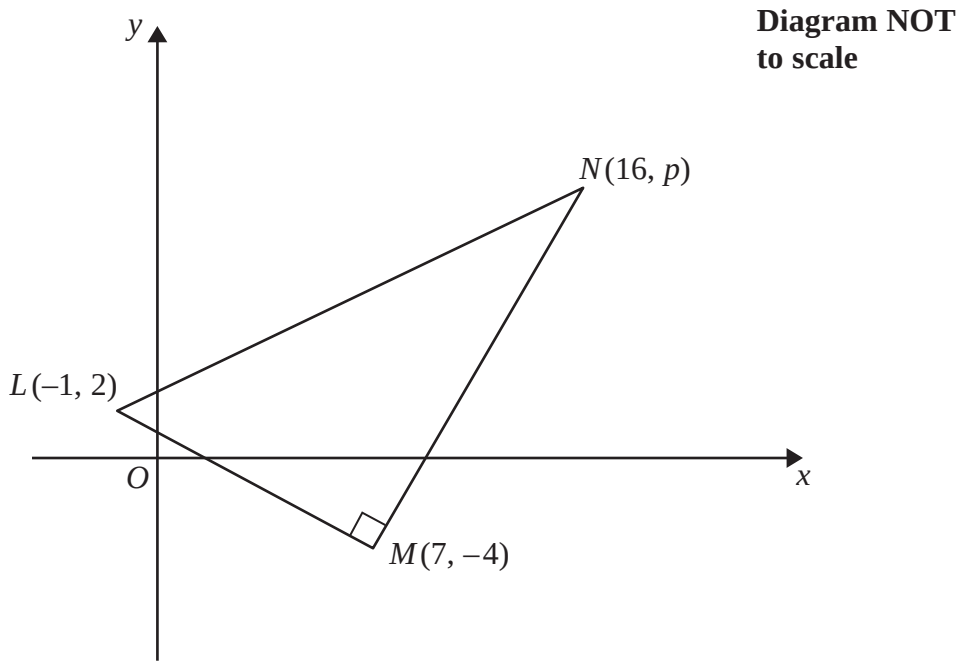

Figure 2

Figure 2 shows a right angled triangle *LMN*.

The points *L* and *M* have coordinates (–1, 2) and (7, –4) respectively.

(a) Find an equation for the straight line passing through the points *L* and *M*.

Give your answer in the form $ax + by + c = 0$, where *a*, *b* and *c* are integers.

(4)

Given that the coordinates of point *N* are (16, *p*), where *p* is a constant, and angle *LMN* = 90°,

(b) find the value of *p*.

(3)

Given that there is a point *K* such that the points *L*, *M*, *N*, and *K* form a rectangle,

(c) find the *y* coordinate of *K*.

(2)

P 4 3 1 4 6 A 0 1 4 3 2

Leave blank

Question 7 continued

Leave blank

8. $$\frac{dy}{dx} = 6x^{-\frac{1}{2}} + x\sqrt{x}, \quad x > 0$$

Given that $y = 37$ at $x = 4$, find y in terms of x, giving each term in its simplest form.

(7)

Leave blank

9. The curve C has equation $y = \frac{1}{3}x^2 + 8$

The line L has equation $y = 3x + k$, where k is a positive constant.

(a) Sketch C and L on separate diagrams, showing the coordinates of the points at which C and L cut the axes.

(4)

Given that line L is a tangent to C,

(b) find the value of k.

(5)

Leave blank

Question 9 continued

Leave blank

10. Xin has been given a 14 day training schedule by her coach.

Xin will run for A minutes on day 1, where A is a constant.

She will then increase her running time by $(d + 1)$ minutes each day, where d is a constant.

(a) Show that on day 14, Xin will run for

$$(A + 13d + 13) \text{ minutes.}$$

(2)

Yi has also been given a 14 day training schedule by her coach.

Yi will run for $(A - 13)$ minutes on day 1.

She will then increase her running time by $(2d - 1)$ minutes each day.

Given that Yi and Xin will run for the same length of time on day 14,

(b) find the value of d.

(3)

Given that Xin runs for a total time of 784 minutes over the 14 days,

(c) find the value of A.

(3)

Leave blank

Question 10 continued

Leave blank

11.

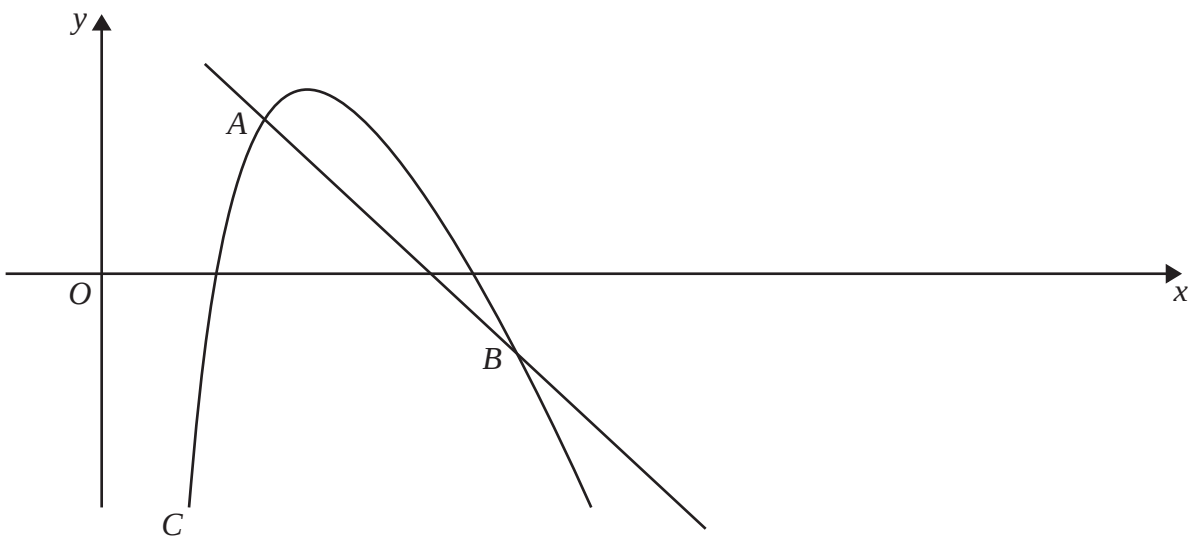

Figure 3

A sketch of part of the curve C with equation

$$y = 20 - 4x - \frac{18}{x}, \quad x > 0$$

is shown in Figure 3.

Point A lies on C and has an x coordinate equal to 2

(a) Show that the equation of the normal to C at A is $y = -2x + 7$

(6)

The normal to C at A meets C again at the point B, as shown in Figure 3.

(b) Use algebra to find the coordinates of B.

(5)

P 4 3 1 4 6 A 0 2 8 3 2

Leave blank

Question 11 continued

Q11

(Total 11 marks)

TOTAL FOR PAPER: 75 MARKS

END

June 2014

Centre No.						Paper Reference							Surname	Initial(s)
Candidate No.						6	6	6	3	/	0	1	Signature	

Paper Reference(s)

6663/01

Edexcel GCE

Core Mathematics C1

Advanced Subsidiary

Monday 19 May 2014 – Morning

Time: 1 hour 30 minutes

Examiner's use only

Team Leader's use only

Question Number	Leave Blank
1	
2	
3	
4	
5	
6	
7	
8	
9	
10	
11	
Total	

Materials required for examination
Mathematical Formulae (Pink)

Items included with question papers
Nil

Calculators may NOT be used in this examination.

Instructions to Candidates

In the boxes above, write your centre number, candidate number, your surname, initials and signature.
Check that you have the correct question paper.
Answer ALL the questions.
You must write your answer for each question in the space following the question.

Information for Candidates

A booklet 'Mathematical Formulae and Statistical Tables' is provided.
Full marks may be obtained for answers to ALL questions.
The marks for individual questions and the parts of questions are shown in round brackets: e.g. **(2)**.
There are 11 questions in this question paper. The total mark for this paper is 75.
There are 28 pages in this question paper. Any blank pages are indicated.

Advice to Candidates

You must ensure that your answers to parts of questions are clearly labelled.
You should show sufficient working to make your methods clear to the Examiner.
Answers without working may not gain full credit.

This publication may be reproduced only in accordance with Pearson Education Ltd copyright policy.
©2014 Pearson Education Ltd.

Printer's Log. No.
P43014A
W850/R6663/57570 5/5/5/1/

P 4 3 0 1 4 A 0 1 2 8

Turn over

PEARSON

Leave blank

1. Find

$$\int (8x^3 + 4)\, dx$$

giving each term in its simplest form.

(3)

Q1

(Total 3 marks)

P 4 3 0 1 4 A 0 2 2 8

Leave blank

2. (a) Write down the value of $32^{\frac{1}{5}}$

(1)

(b) Simplify fully $(32x^5)^{-\frac{2}{5}}$

(3)

Q2

(Total 4 marks)

Leave blank

3. Find the set of values of x for which

(a) $3x - 7 > 3 - x$

(2)

(b) $x^2 - 9x \leqslant 36$

(4)

(c) **both** $3x - 7 > 3 - x$ **and** $x^2 - 9x \leqslant 36$

(1)

Leave blank

4.

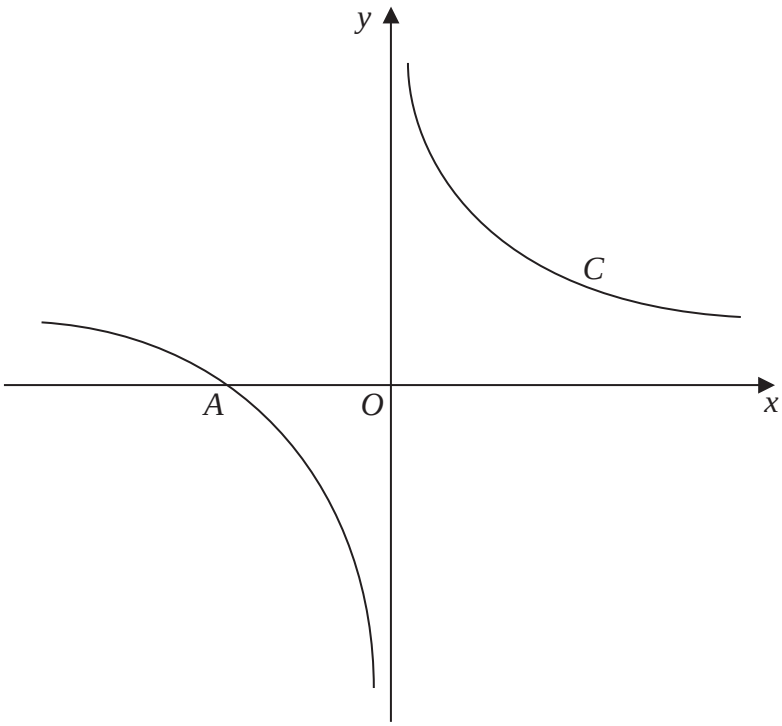

Figure 1

Figure 1 shows a sketch of the curve C with equation

$$y = \frac{1}{x} + 1, \qquad x \neq 0$$

The curve C crosses the x-axis at the point A.

(a) State the x coordinate of the point A.

(1)

The curve D has equation $y = x^2(x - 2)$, for all real values of x.

(b) A copy of Figure 1 is shown on page 7.
On this copy, sketch a graph of curve D.
Show on the sketch the coordinates of each point where the curve D crosses the coordinate axes.

(3)

(c) Using your sketch, state, giving a reason, the number of real solutions to the equation

$$x^2(x - 2) = \frac{1}{x} + 1$$

(1)

P 4 3 0 1 4 A 0 6 2 8

Leave blank

Question 4 continued

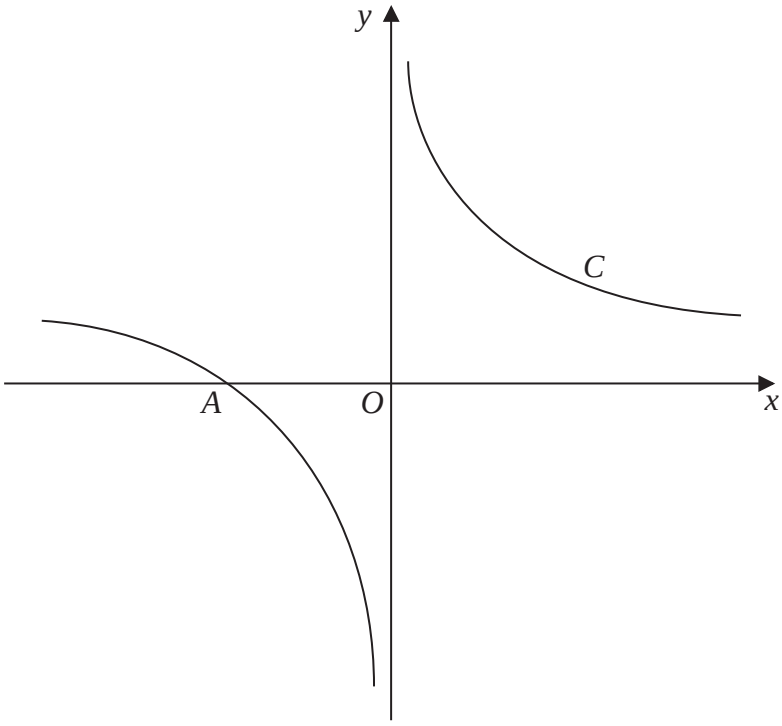

Figure 1

Q4

(Total 5 marks)

Leave blank

5. A sequence of numbers $a_1, a_2, a_3 \ldots$ is defined by

$$a_{n+1} = 5a_n - 3, \qquad n \geqslant 1$$

Given that $a_2 = 7$,

(a) find the value of a_1

(2)

(b) Find the value of $\sum_{r=1}^{4} a_r$

(3)

Leave blank

6 (a) Write $\sqrt{80}$ in the form $c\sqrt{5}$, where c is a positive constant.

(1)

A rectangle R has a length of $(1 + \sqrt{5})$ cm and an area of $\sqrt{80}$ cm^2.

(b) Calculate the width of R in cm. Express your answer in the form $p + q\sqrt{5}$, where p and q are integers to be found.

(4)

Leave blank

7. Differentiate with respect to x, giving each answer in its simplest form.

(a) $(1 - 2x)^2$

(3)

(b) $\dfrac{x^5 + 6\sqrt{x}}{2x^2}$

(4)

Leave blank

8. In the year 2000 a shop sold 150 computers. Each year the shop sold 10 more computers than the year before, so that the shop sold 160 computers in 2001, 170 computers in 2002, and so on forming an arithmetic sequence.

(a) Show that the shop sold 220 computers in 2007.

(2)

(b) Calculate the total number of computers the shop sold from 2000 to 2013 inclusive.

(3)

In the year 2000, the selling price of each computer was £900. The selling price fell by £20 each year, so that in 2001 the selling price was £880, in 2002 the selling price was £860, and so on forming an arithmetic sequence.

(c) In a particular year, the selling price of each computer in £s was equal to three times the number of computers the shop sold in that year. By forming and solving an equation, find the year in which this occurred.

(4)

Leave blank

Question 8 continued

Leave blank

9.

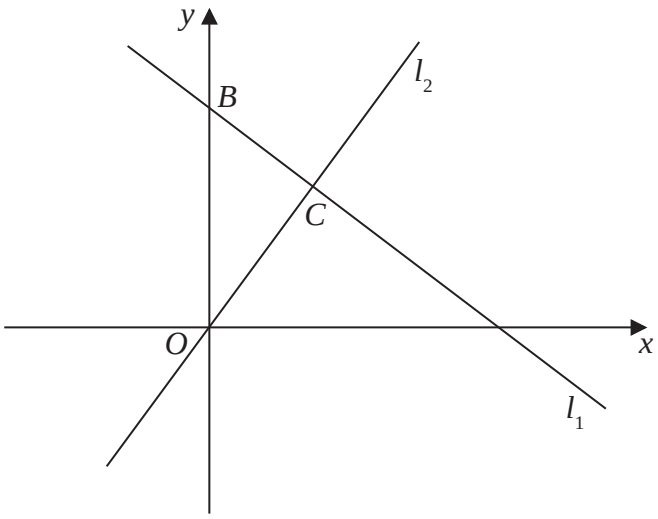

Figure 2

The line l_1, shown in Figure 2 has equation $2x + 3y = 26$

The line l_2 passes through the origin O and is perpendicular to l_1

(a) Find an equation for the line l_2

(4)

The line l_2 intersects the line l_1 at the point C.

Line l_1 crosses the y-axis at the point B as shown in Figure 2.

(b) Find the area of triangle OBC.

Give your answer in the form $\frac{a}{b}$, where a and b are integers to be determined.

(6)

P 4 3 0 1 4 A 0 1 8 2 8

Leave blank

Question 9 continued

Leave blank

10. A curve with equation $y = \mathrm{f}(x)$ passes through the point (4, 25).

Given that

$$\mathrm{f}'(x) = \frac{3}{8}x^2 - 10x^{-\frac{1}{2}} + 1, \qquad x > 0$$

(a) find $\mathrm{f}(x)$, simplifying each term.

(5)

(b) Find an equation of the normal to the curve at the point (4, 25).

Give your answer in the form $ax + by + c = 0$, where a, b and c are integers to be found.

(5)

Leave blank

Question 10 continued

Leave blank

11. Given that

$$f(x) = 2x^2 + 8x + 3$$

(a) find the value of the discriminant of $f(x)$.

(2)

(b) Express $f(x)$ in the form $p(x + q)^2 + r$ where p, q and r are integers to be found.

(3)

The line $y = 4x + c$, where c is a constant, is a tangent to the curve with equation $y = f(x)$.

(c) Calculate the value of c.

(5)

Leave blank

Question 11 continued

Q11

(Total 10 marks)

TOTAL FOR PAPER: 75 MARKS

END

Core Mathematics C1

Mensuration

Surface area of sphere = $4\pi r^2$

Area of curved surface of cone = $\pi r \times$ slant height

Arithmetic series

$u_n = a + (n - 1)d$

$S_n = \frac{1}{2}n(a + l) = \frac{1}{2}n[2a + (n - 1)d]$